ANGLES COMPLEMENTARIS I SUPLEMENTARIS I

1. Calcula l'angle complementari i el suplementari dels angles següents: 44º, 47º, 79º, 14º, 121º, 175º. **En el cas que no tingui, marca amb una X.**

	Angle complementari	Angle suplementari
44º	º	º
47º	º	º
79º	º	º
14º	º	º
121º	º	º
175º	º	º

2. Escriu com són els angles (complementaris o suplementaris). Després, calcula l'angle que falta.

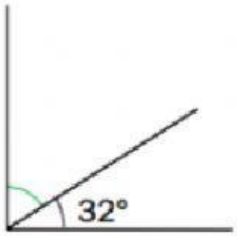

ANGLE =

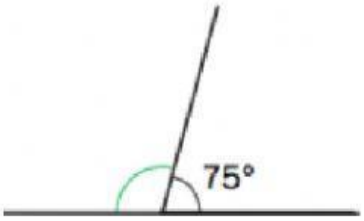

ANGLE =

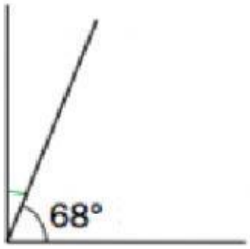

ANGLE =

ANGLE =

LIVEWORKSHEETS

3. Mesura amb el transportador l'angle A. Quant fa l'angle B?

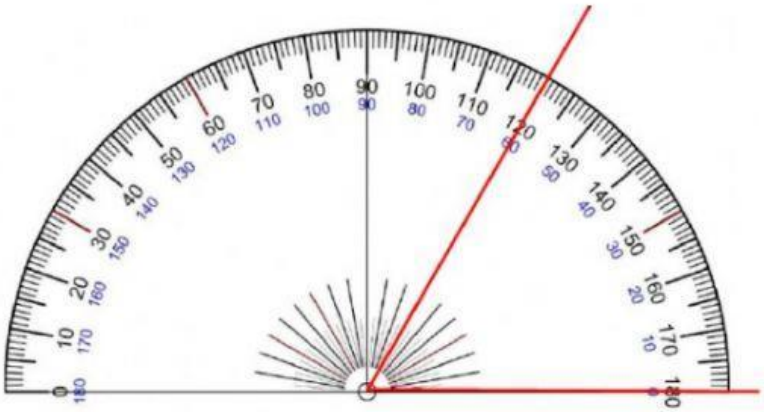

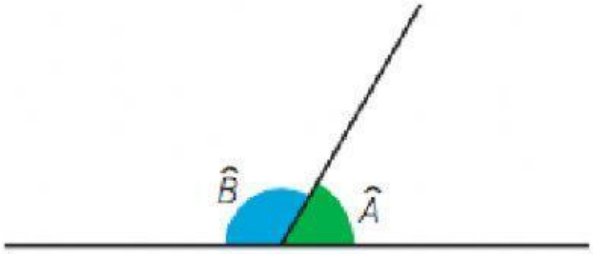

$\hat{A}$ =

$\hat{B}$ =

4. A la figura següent, les rectes t i u són paral·leles, i r i s són perpendiculars. Sabent que A fa 157º i que F fa 113º, calcula el valor dels altres angles.

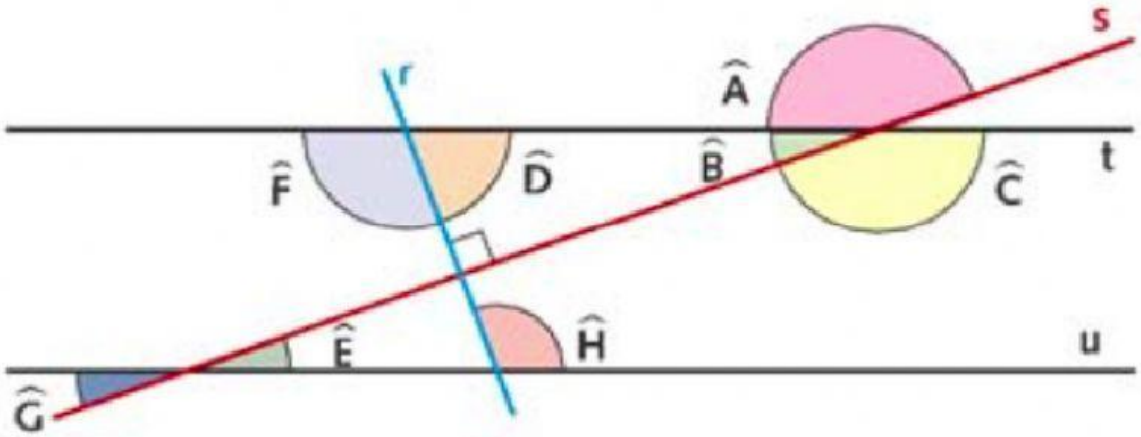

$\hat{A}$ =	$\hat{C}$ =	$\hat{E}$ =	$\hat{G}$ =
$\hat{B}$ =	$\hat{D}$ =	$\hat{F}$ =	$\hat{H}$ =

LIVEWORKSHEETS

5. Troba el valor dels angles desconeguts:

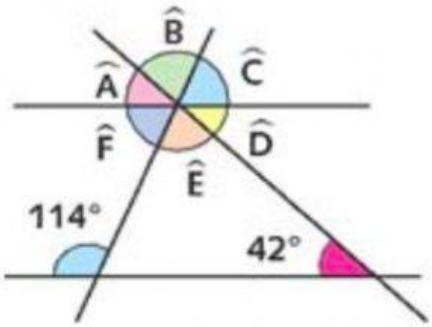

$\hat{A}$ =

$\hat{B}$ =

$\hat{C}$ =

$\hat{D}$ =

$\hat{E}$ =

$\hat{F}$ =

6. Sense utilitzar el transportador, calcular quant fan els angles indicats:

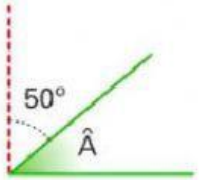

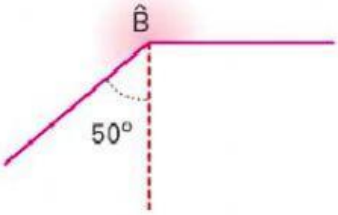

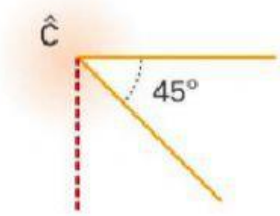

$\hat{A}$ =

$\hat{B}$ =

$\hat{C}$ =

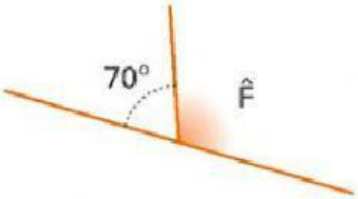

$\hat{D}$ =

$\hat{E}$ =

$\hat{F}$ =

LIVEWORKSHEETS