Запиши кількість елементів у кожній групі. Виконай порівняння: постав відповідний знак >, <, =.

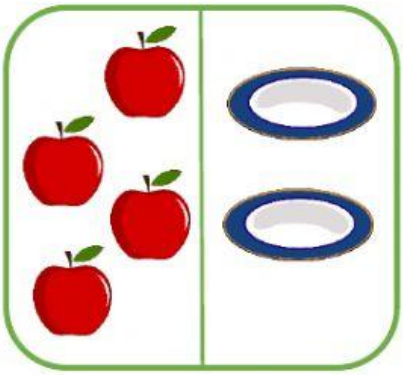

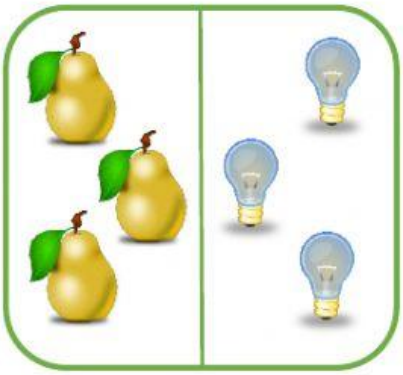

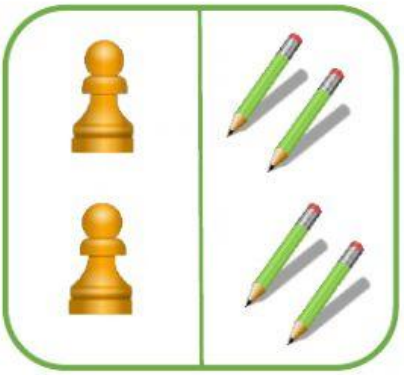





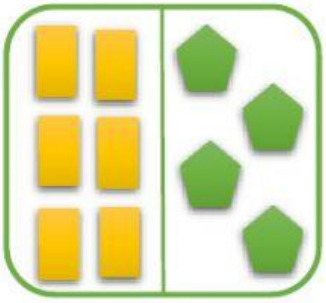



Запиши в клітинки такі числа, щоб отримати правильну нерівность

4 < ☐ 5 > ☐ 6 > ☐ 5 < ☐

Novatika.org

LIVEWORKSHEETS