Name: _____ **Date:** _____

Mathematics

Solid Shapes

Drag the pictures at the bottom into the correct column.

cone	sphere	cube	cylinder	pyramid

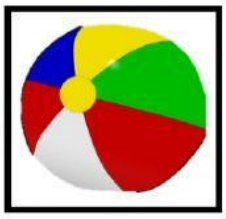

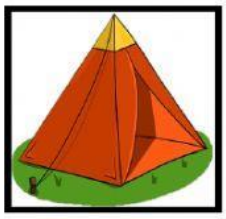



Sylatheia Gierszewski

LIVEWORKSHEETS