Name: _____ Date: _____

Mathematics Review

1. Write the number five thousand, four hundred three in standard form.

   Answer: _____

2. Write the Roman Numeral that is needed to complete the pattern below.

V	VI	_____	VII

3. Write the numbers shown on the ice cream from greatest to least.

   Answer: _____, _____, _____, _____, _____.

4. Fill in the missing number in the pattern to complete it.

25	____	15	10	5

5. Click on the group that shows the largest number of triangles.

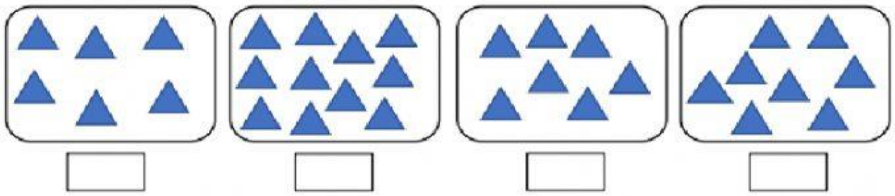



6. **(a.)** Write the VALUE of the underlined digit in the number shown above.

   Answer: _____

   (b.) Write the PLACE of the digit **"5"** shown in the number above.

   Answer: _____



7. (a) Write the number that shows how many apples are in the set above.

   Answer: _____

LIVEWORKSHEETS

7. (b) Write the multiplication sentence that is shown in the set of apples.

Answer: ____ x ____ = ____

(c) Write the repeated addition sentence that is shown in the set of apples.

Answer: _____

LIVEWORKSHEETS