Standard One

Term One Test 2021

Mathematics

Directions for Test

- This test has a total of 12 questions.
- Read EACH item CAREFULLY before answering it.
- Marks will be awarded for correct answers.
- Follow instructions carefully in this test.
- Answer ALL questions.
- This test must be submitted by the deadline time.

LIVEWORKSHEETS

1. Complete the table by typing the word name or numeral.

WORD NAME	NUMERAL
thirty-four	
	65
	12
fifty-five	
	78
eleven	
	99

2. Complete the following questions using the table below. (Write the word names and **not** the numerals.)



Monkey	Leopard	Squirrel	Fox	Bird	Elephant	Deer	Dog	Duck	Frog

If the monkey is the first animal, then:

a. Which animal is second? _____

b. What place is the Fox in? _____

c. What place is the Dog in? _____

d. Which animal is fifth? _____

e. Which animal is last? _____

LIVEWORKSHEETS

3. Type the following numbers in ascending order.

85	23	4	77	43	19
_____	_____	_____	_____	_____	_____

4. Type the following numbers in descending order.

92	38	6	17	65	41
_____	_____	_____	_____	_____	_____

5. Fill in the missing numbers.

A. 3 ___ 9 12 ___ 18 ___ 24 ___ 30

B. ___ 4 ___ 8 ___ 12 ___ 16 ___ 20

C. 5 ___ 15 ___ 25 ___ 35 ____ 45 ____

D. ___ 20 ____ 40 ___ 60 ____ 80 ____ 100

6. Read carefully and complete the following:

a. Select the even numbers.

3 34 31 27 56 18

b. Select the odd numbers.

7 11 20 6 13 15

LIVEWORKSHEETS

7. Add the following:

a) 4
+7
_____
_____

b) 8
+4
_____
_____

c) 9
+5
_____
_____

d) 6
+7
_____
_____

8. Fill in the names of the shapes using the following words.

Cube **Sphere** **Cuboid** **Cone**

Name of Shape	3D Shapes	Number of Faces	Number of Edges	Number of Vertices
				
	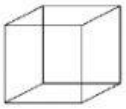			

LIVEWORKSHEETS

9. Look carefully at the house in the picture below.

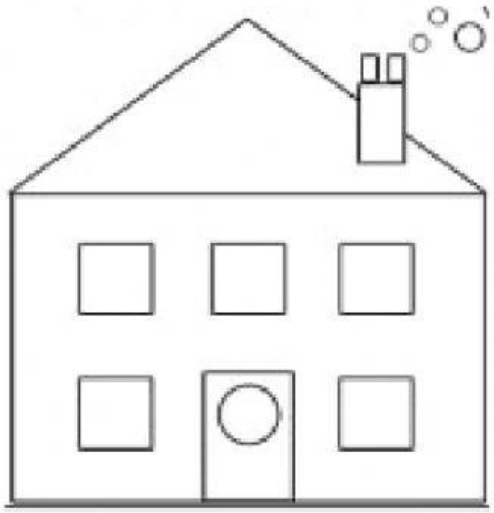

Answer the following questions.

a) In this house you can look through me to see outside. I have 4 equal corners and 4 equal sides. What am I? _____.

b) I am as round as a ring. I am a _____.

c) How many rectangles do you see? _____.

d) My roof is in the shape of a _____.

LIVEWORKSHEETS

10. Measurements

a. Type in the measurments using long, longer and longest on the line provided.

_____

_____

_____

b. Type in the measurments using short, shorter and shortest on the line provided.

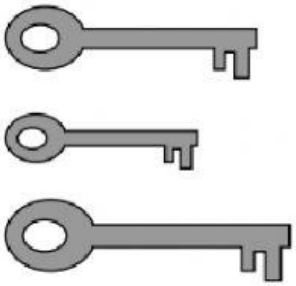

_____

_____

_____

c. Type in the measurments using long, longer and longest on the line provided.



_____

_____

_____

LIVEWORKSHEETS

d. Type in the measurments using short, shorter and shortest on the line provided.

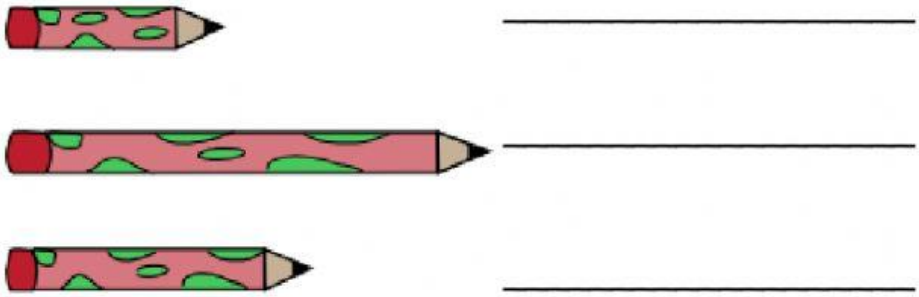

11. Non-Standard Units of Measurement

Type the number paperclips and blocks used to measure each item in the box provided.

LIVEWORKSHEETS

paper clips

blocks



paper clips

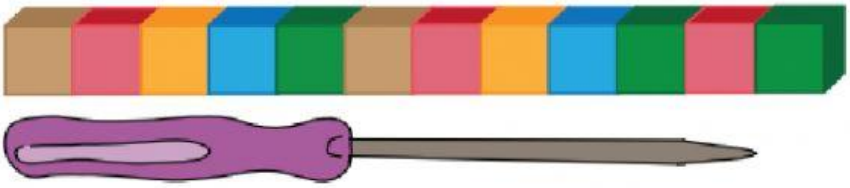

blocks

LIVEWORKSHEETS

12. Complete the following activities.

Count by 3's and select the numbers.

1	2	3	4	5	6	7	8	9	10
11	12	13	14	15	16	17	18	19	20
21	22	23	24	25	26	27	28	29	30

Count by 5's and select the numbers.

1	2	3	4	5	6	7	8	9	10
11	12	13	14	15	16	17	18	19	20

Count by 10's and select the numbers.

1	2	3	4	5	6	7	8	9	10
11	12	13	14	15	16	17	18	19	20
21	22	23	24	25	26	27	28	29	30
31	32	33	34	35	36	37	38	39	40
41	42	43	44	45	46	47	48	49	50

END OF TEST

LIVEWORKSHEETS