Finding the fraction of a set



1/2 of 10 _____

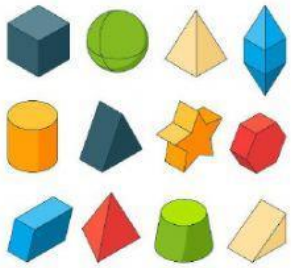

1/3 of 12 ____



1/4 of 24 ____

1/3 of 6 ____

1/2 of 8 ____

1/4 of 16 ____

LIVEWORKSHEETS