Name:

Prime Factorization- Factor Tree

Find the Prime Factors of the following numbers. Be sure to list the prime factors in order from least to greatest.

Examples:

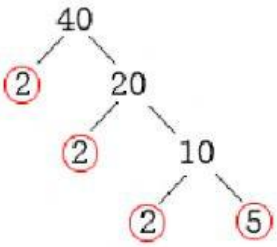

$40 = 2 \times 2 \times 2 \times 5$

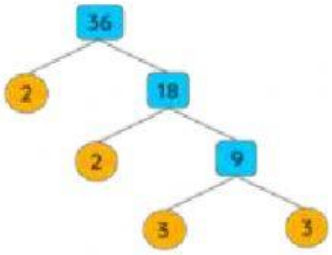

$36 = 2 \times 2 \times 3 \times 3$

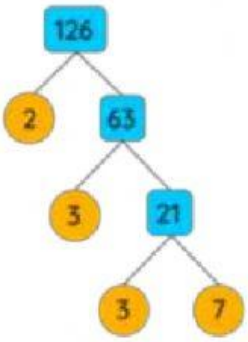

$126 = 2 \times 3 \times 3 \times 7$

1.

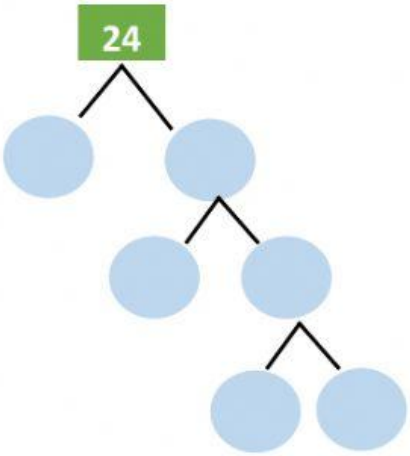

_____×_____×_____×_____= 24

2.

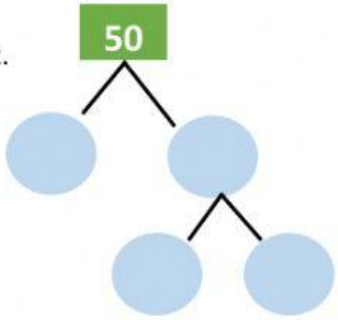

_____×_____×_____= 50

3.

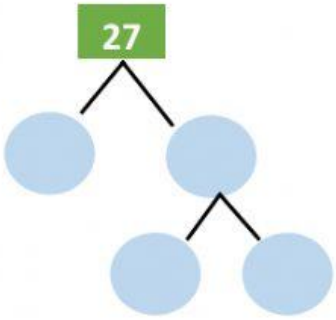

_____×_____×_____= 27

4.

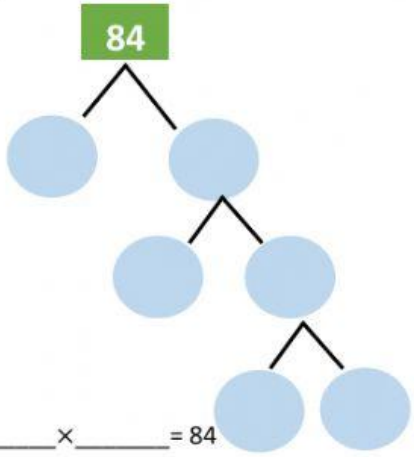

_____×_____×_____×_____= 84

LIVEWORKSHEETS