Section A

Bahagian A

Each questions is followed by options **A**, **B**, and **C**. circle the correct answer.

Setiap soalan mengandungi pilihan jawapan A,B, dan C. Bulatkan jawapan yang betul.

1. . Which the following food tastes sour when eaten?
   Antara berikut , makanan yang manakah mempunyai rasa masam apabila dimakan?

A



B

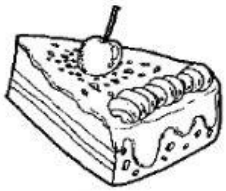

C

2. Which of the following is a shelter for birds?
   Antara berikut yang manakah tempat tinggal burung?

A



B



C

LIVEWORKSHEETS

3. Which one of the following isa living things?
Antara yang berikut yang manakah benda hidup?

A

B

C

4. Which of the following is **not** the characteristic of living things?
Yang manakah antara berikut **bukan**ciri-ciribenda hidup?

A. Can make their own food
Boleh membuatmakannyasendiri

B. Can reproduce
Boleh membiak

C. Can breathe
Boleh bernafas

LIVEWORKSHEETS

5

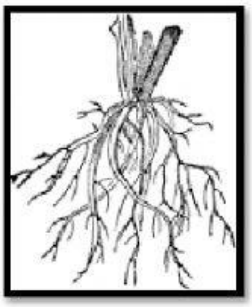

What is the importance of the part of the plant shown above?
Apakah kepentingan bahagian tumbuhan di atas?

A To make food
Menghasilkan makanan

B To absorb water
Menyerap air

C To support the plant
Menyokong tumbuhan

6. What is the plant identified?
Apakah tumbuhan yang mempunyai ciri ciri dibawah?

Flowering plant Berbunga
Has fibrous roots Akar serabut
Woody stem Batang berkayu
Netted veined leaves Daun urat berjaring

A Grass - Rumput

B Banana plant – Pokok pisang

C Mango tree – Pokok mangga

LIVEWORKSHEETS

7 The diagram below shows a tree.
Rajah di bawah menunjukkan sebatang pokok

Which of the following are the basic needs for the above tree?
Antara berikut, yang mana kah keperluan asas pokok tersebut?

A Water, food and air.
Air, makanan dan udara

B Air, water and sunlight
Udara, air dan cahaya matahari

C Food, car, shelter and sunlight
Makanan, kereta dan cahaya matahari

8 Which of the following would be attracted to magnets?
Anatara berikut, yang manakah akan tertarik dengan magnet?

A Nail Paku

B Bottle Botol

C Towel Tuala

LIVEWORKSHEETS

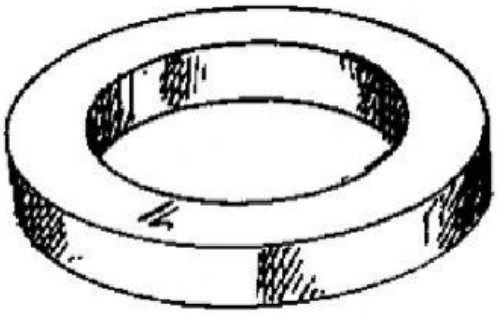

9 What is the name of the magnet?

Apakah jenis magnet dia atas?

A Horseshoe magnet
Magnet ladam kuda

B Ring magnet
Magnet cincin

C Cylindrical magnet

10 Diagram 1 shows two magnets placed facing each other.

Rajah dibawah menunjukkan dua magnet.

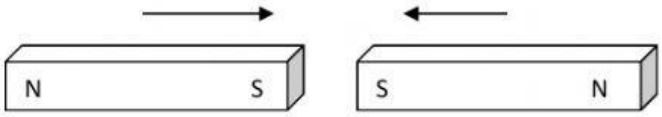

What would happen?

Apakah yang akan terjadi?

A Magnets repel
Magnet menolak sesama sendiri

B Magnets break
Magnet rosak

C Magnets attract

LIVEWORKSHEETS

11 Which of the following is strongest magnet?

Antara berikut yang manakah magnet yang paling kuat?

A 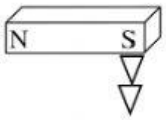

C 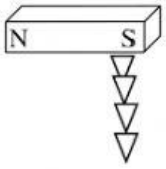

B 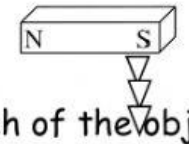

12 Which of the objects below using magnet?

Antara berikut objek manakah menggunakan magnet?

A.

C

B

13 Which object can absorb water?

Objek manakah yang menyerap air?

A 

C

B

LIVEWORKSHEETS

14. Which object is protect our body from getting wet in rain?
Objek manakah yang membantu untuk melindungi badan daripada hujan?

A 

C

B

15. Which object can absorb the most water?
Objek manakah menyerap paling banyak air?

A Towel Tuala
B Tissue paper Tisu
C Handkerchief
Sapu tangan

16. The beach contains a lot of _____
Pantai mengandungi banyak _____

A garden soil Tanah kebun
B sand Pasir
C valley soil
Tanah lembah

LIVEWORKSHEETS

17.



The above diagram shows a _____.

Rajah di atas menunjukkan _____

A river Sungai

B beach Pantai

C mountain Gunung

18. Which area and the type of soil are correctly matched?
Yang manakah kawasan dan jenis tanah dipadankan dengan betul?

	Area Kawasan	**Type of soil Jenis Tanah**
A	Beach Pantai	Garden soil Tanah Kebun
B	Desert Gurun	Clay Tanah Liat
C	Paddy field Sawah padi	Clay Tanah Liat

LIVEWORKSHEETS

19. The shape of the book is a _____.
Bentuk buku adalah _____

A Cone Kon

B cuboid Kuboid

C pyramid Piramid

20. Why ball is made of sphere?
Mengapakah bentuk bola sfera?

A Prettier Lebih cantik

B More stable Lebih stabil

C Easy to move Senang bergerak

LIVEWORKSHEETS