1. Multzokatu 10naka bolatxo gorriak.

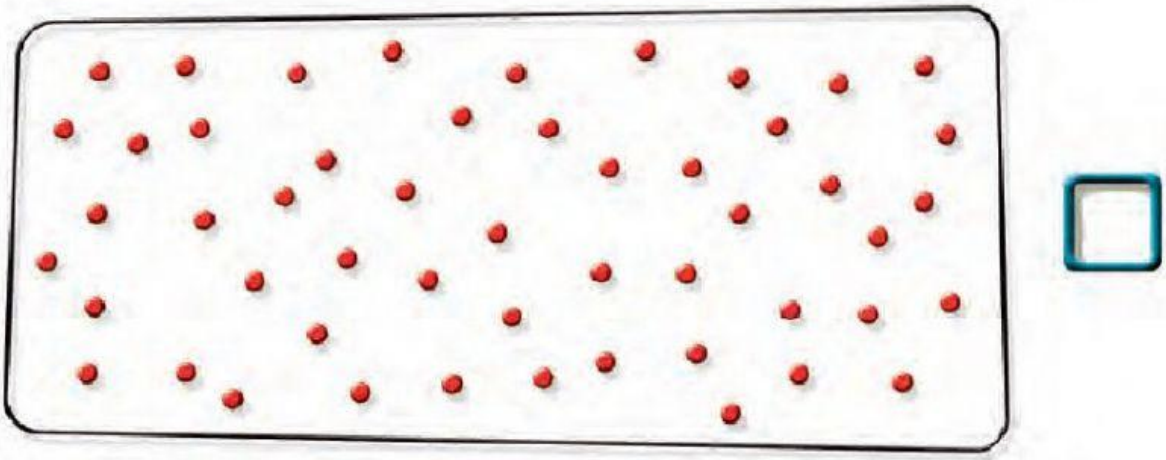

2. Idatzi zein diren zenbaki hauek:

- Hirurogeita hamasei:
- Hirurogeita bost:
- Berrogeita bederatzi:
- Hamabi:
- Hogeita hemeretzi:
- Laurogei:

3. Zein dira zenbaki hauek?

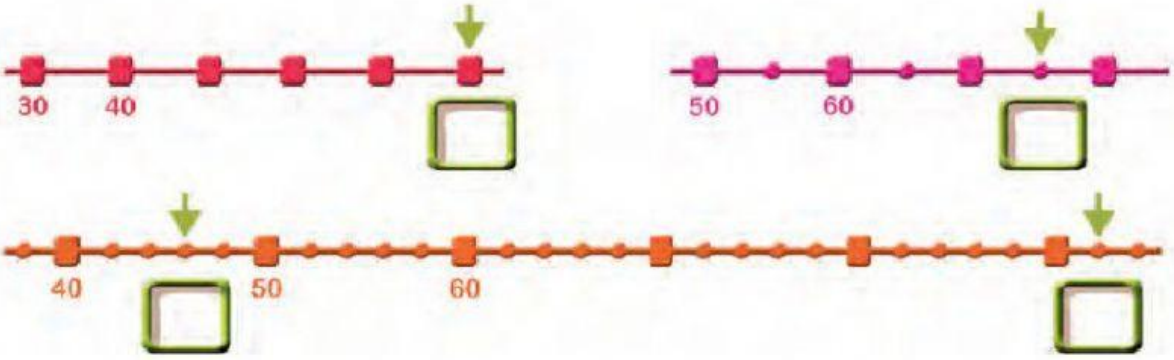

4. Ordenatu txikitik handira.

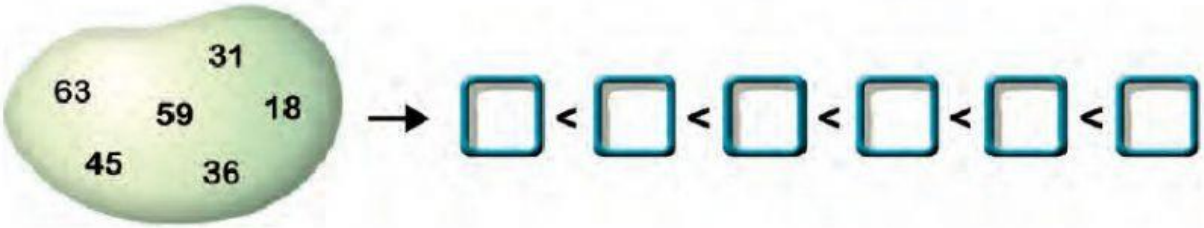

LIVEWORKSHEETS

5. Markatu gurutzeak taula honetan itsulapikoan marrazkiak zein lekutan dauden adierazteko.

	Goian	Behean	Aurrean	Atzean	Eskuinean	Ezkerrean
■						
●						
■						
●						

6. Egin eragiketak.

37 + 44 = ☐☐	52 + 19 = ☐☐	25 + 48 = ☐☐	30 + 46 = ☐☐	64 + 16 = ☐☐
68 − 13 = ☐☐	72 − 18 = ☐☐	57 − 19 = ☐☐	83 − 56 = ☐☐	92 − 31 = ☐☐

7. Asteko eguna. Idatzi falta direnak.

ASTELEHENA _____ **ASTEAZKENA**

OSTEGUNA _____ _____

IGANDEA

LIVEWORKSHEETS