Name _____ LESSON 11.3

Skip Count by 2s, 5s, and 10s

Skip count.
Write how many.

1.



2 4 6 ____ ____

2.



5 10 ____ ____ ____ ____

3.

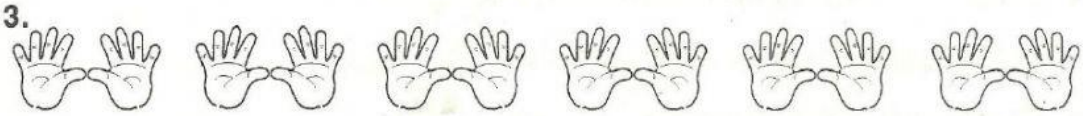

10 20 ____ ____ ____ ____

Counting by 2s

a. Find the total number of fish by counting by 2s.



Counting by 5s

a. Find the total number of fish by counting by 5s.



LIVEWORKSHEETS