SERI MULIA SARJANA SCHOOL

Negara Brunei Darussalam

Year 3 – Mathematics

Counting to 10 000

Name : _____

Class : _____ Date : _____

How many ⬚ are there?

1. 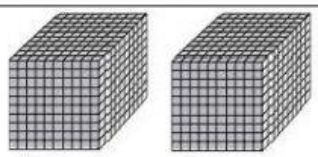				
2. 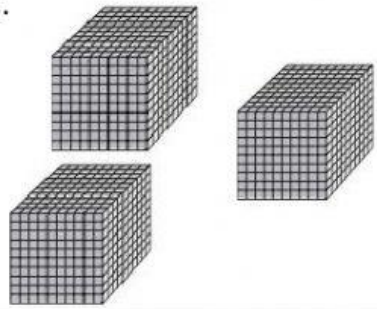				
3. 				
4. 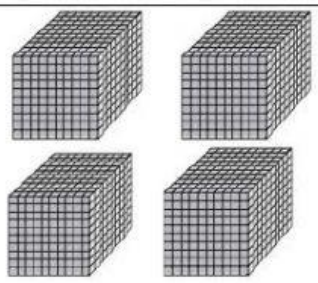				
5.			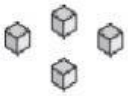	

LIVEWORKSHEETS

Write the numbers in words.

6. 9684

7. 2840

8. 1276

Match them to the correct pair.

9.	Two thousand, three hundred and fifty one	6980
10.	Six thousand,nine hundred and eighty	3012
11.	Three thousand and twelve	2351

Complete the number patterns.

12. 8840, 8850, _____ , _____ , 8880, 8890

13. 2020, _____ , _____ , 5020, 6020, 7020

What is the number shown on the abacus stand?

14.

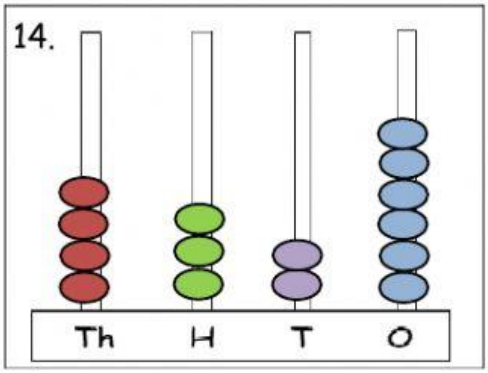

15.

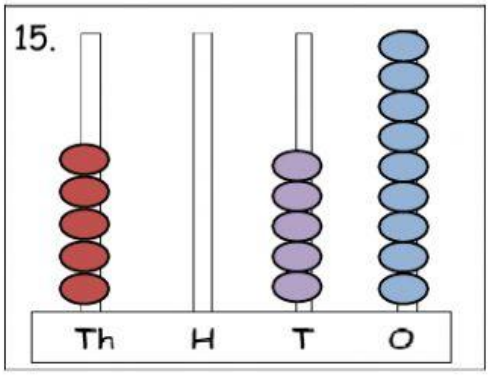

LIVEWORKSHEETS