GIMNASIO INTEGRAL CYGNI DE CARTAGENA
Nit. 900.676.938 – 9
Aprobado por la Secretaría de Educación Distrital mediante Licencia de Funcionamiento, Resolución N°3567 del 13 de agosto de 2020
Código DANE 313001030131
DESARROLLAMOS TALENTO PARA VIVIR UN MUNDO MEJOR
Grade: 4º GRADE

EXAMEN SOCIAL STUDIES 4º PERIODO

NOMBRE:_____**FECHA:**_____**NOTA:**_____

1. What is the significance of these images?

a) calm
b) peace
c) happy
d) different

2. How long is a year?

a) 100 years
b) 10 years
c) 12 months
d) 1000 years

3. Completed: According to the chronological organization 100 year is a:



a) century
b) year
c) millennium

4. Drag the words to complete the chart.

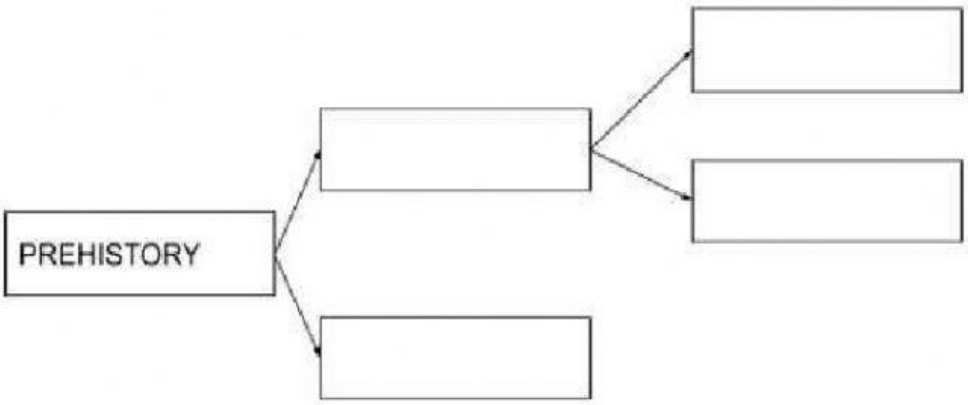

PALAEOLITHIC
METAL AGE
STONE AGE
NEOLITHIC

LIVEWORKSHEETS

5. Write **Paleolithic** or **Neolithic**.

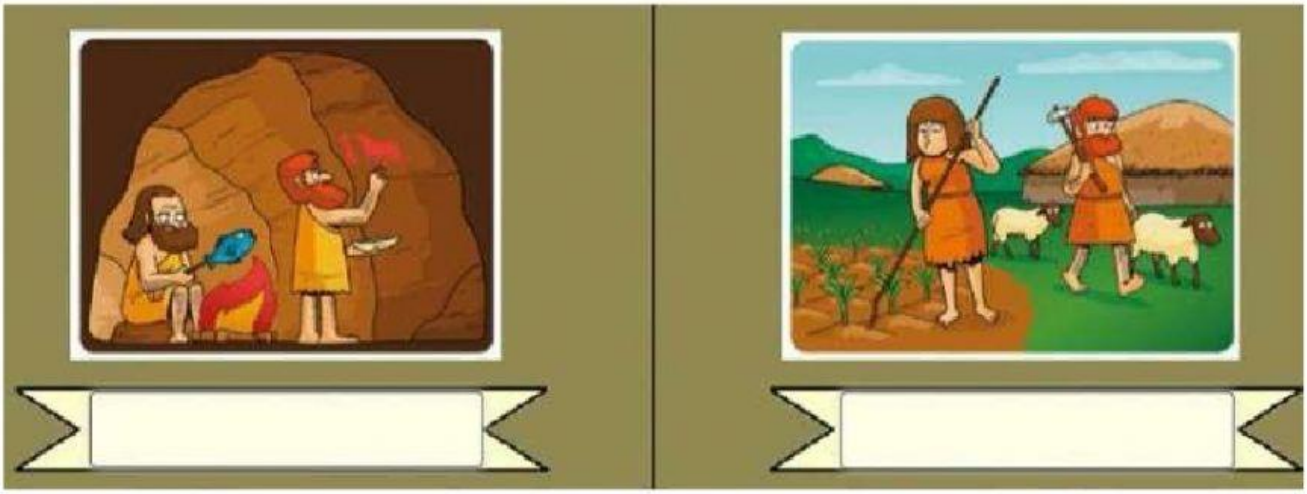

6. Choose the correct option: (**both:** quiere decir ambos)

- They were nomadic:
- They hunted animals and gathered fruits:
- They farmed animals
- They lived in caves:
- They used fire and stone:

7. Answer: this picture represent:

a) chibchas

b) caribs

c) Arawaks

LIVEWORKSHEETS

8. **Answer:** which culture represent this picture?

a) chibchas

b) caribs

c) arawaks

9. Write the name of the culture that represent this picture

10. Completed: is the study of the human past using material remains.

Blessings!!

LIVEWORKSHEETS

Atte. Miss Mary Cuadros

LIVEWORKSHEETS