Write the mass of the objects.

a

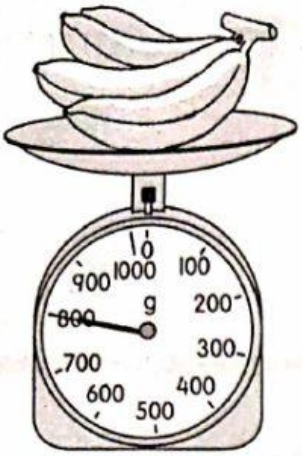

b



c



d



e

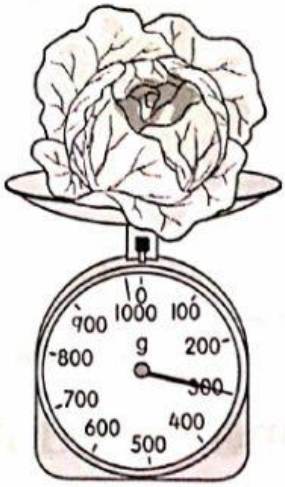

f



g



h



i



Scanned with CamScanner
LIVEWORKSHEETS