LKPD STRUKTUR DAN FUNGSI JARINGAN TUMBUHAN

OLEH: SULASTRI, S.Pd
SMP N 2 BUMIRATUNUBAN

NAMA	
KELAS	

Perhatikan gambar! Sebutkan nama gambar tersebut sesuai pilihan yang disediakan!

NO	GAMBAR	NAMA
1.	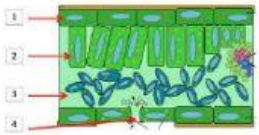	
2.	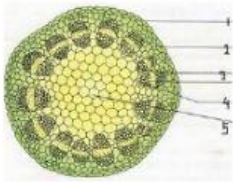	
3.		

LIVEWORKSHEETS

4.	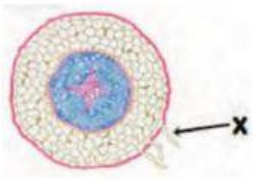	
5.	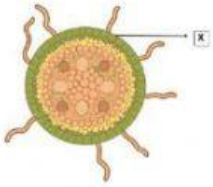	

Perhatikan gambar berikut! Sebutkan nama bagian sesuai yang ditunjukkan oleh nomor dan fungsinya!

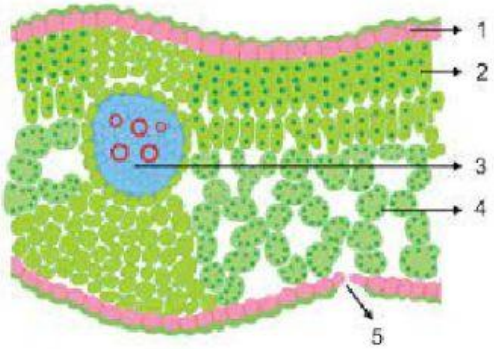

NO	Nama jaringan	Fungsi
1		
2		
3		
4		
5		

LIVEWORKSHEETS

Perhatikan gambar! Sebutkan nama bagian sesuai yang ditunjuk oleh nomor dengan menarik nama-nama yang ada!

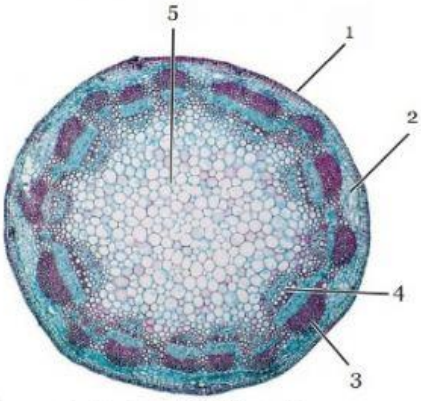

Sumber: Campbell *et al.* 2008

KORTEKS EMPULUR EPIDERMIS XILEM FLOEM

Pasangkan teknologi yang ada di sebelah kiri dengan struktur jaringan tumbuha n yang menginspirasinya di sebelah kanan!



LIVEWORKSHEETS

Panel Surya

Buah Durian

Penjernih air

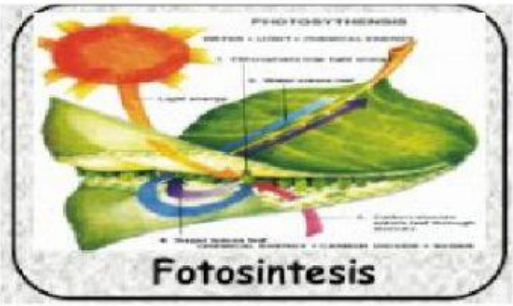

Fotosintesis

LIVEWORKSHEETS

LIVEWORKSHEETS