COMPASES

1) ¿Cuántos tiempos dura cada compás? Une con flechas.



4 tiempos



2 tiempos



3 tiempos
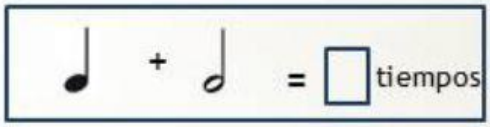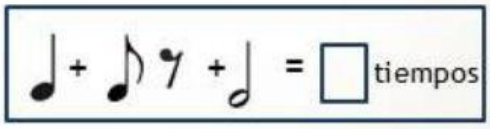
2) Completa estas sumas. Mira este ejemplo.