Australian International School, Laos
PRIMARY DEPARTMENT
SY 2021-2022

Final Score:
/

Term 1 Examination

Subject: Science

Year 2

Name:

Date:

READ THE FOLLOWING INSTRUCTIONS:

You may use a black OR blue pen

The number of marks is given in brackets [ ] at the end of each question

The total number of marks for this paper is: 50

This document contains 13 pages to be completed

LIVEWORKSHEETS

Science 2

1. Look at the picture below and identify if it is an example of living thing or non-living thing.

A. Living Thing
B. Non-Living Thing

....[1]

2. Study the weather forecast below.



On Sunday, the weather forecast will be _____.
A. Sunny
B. Stormy
C. Rainy

....[1]

LIVEWORKSHEETS

Science 2

3. What symbol best describe the weather forecast below?

A.

B.

C.

....[1]

4. This weather instrument is used to measure the precipitating rain in a given amount of time per unit.
   A. Wind vane
   B. Rain gauge
   C. Satellite ....[1]

5. Choose which of the following pictures below an example of non-living thing is.

A.

B.

C.

....[1]

6. Animals such as lizard, snakes and tortoises like to bask in the sun.

A. True B. False C. Either A or B D. Both A and B

....[1]

LIVEWORKSHEETS

Science 2

7. Study the weather forecast below.



What will the weather be like on Friday?

A. Snowy

B. Cloudy

C. Windy

....[1]

8. The sentences below are the descriptions of where the worms live except for one.

A. Worms can be found in hot and dry environment.

B. Worms can be found in shady environment.

C. Worms can be found in wet environment.

....[1]

9. Which of the following observations would help to identify a living thing?

A. It grows.

B. It cannot move on their own.

C. It cannot make young ones.

.....[1]

LIVEWORKSHEETS

Science 2

10. Here are some living things we see can around.

frog

centipede

chameleon

Write each living thing in the correct box in the table.

tree	log	soil	pond	beach

....[3]

11. Tick the correct sentences and cross out the false statement.

- [ ] Cloud is an example of a non-living moving thing.
- [ ] We can measure the amount of rainfall using a thermometer.
- [ ] We should throw litter anywhere.

....[3]

12. Which of the following is an example of a living thing?

A.

B.

C.

....[1]

LIVEWORKSHEETS

Science 2

13. What do we call the weather instrument in the picture?

A. Thermometer
B. Anemometer
C. Windsock
....[1]

14. Study the weather forecast below.

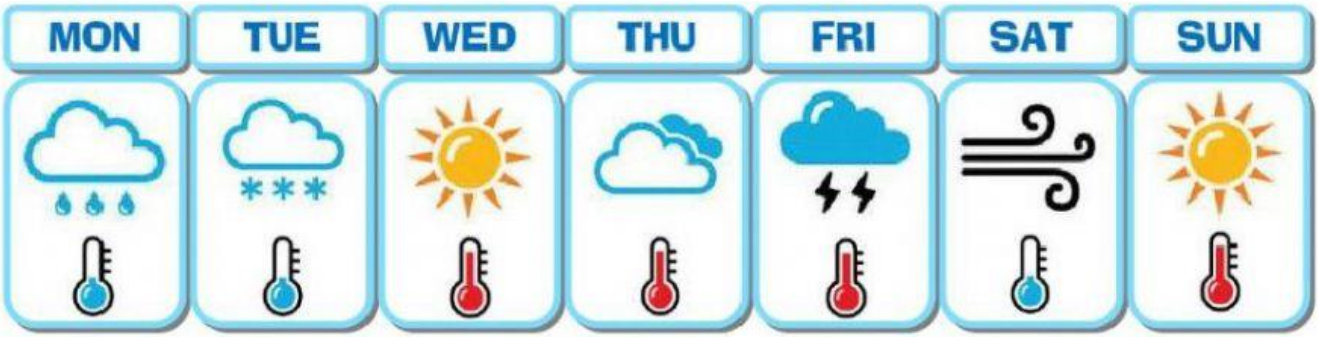

Today is Wednesday; the weather is _____ and _____.
....[2]

LIVEWORKSHEETS

Science 2

15. Some things are living things.

Others have never lived.

Write down each word in the correct box in the table.

pen lion computer

donkey

LIVING THINGS	NON-LIVING THINGS
1.	1.
2.	2.
3.	3.

….[4]

16. Which of these sentences is correct about scorpion?

A. Scorpion can be found in hot and dry environment.
B. Scorpion can be found in shady and wet environment.
C. Scorpion can be found in dry and shady environment.

….[1]

LIVEWORKSHEETS

Science 2

17. What symbol best describe the weather forecast below?

A.

B.

C.

....[1]

18. This weather instrument is used to tell the wind direction. It lets you know what direction the wind is coming from.

A. Anemometer
B. Wind vane
C. Rain gauge ....[1]

19. Why is it important to protect the environment?

A. Many living things may not be able to find food, keep safe of have young if environment is made dirty.
B. To trap the turtle in the net.
C. For the trees to be cut down and birds lose their homes.

....[1]

LIVEWORKSHEETS

Science 2

20. What can you do on a sunny day?

A. Splash in puddles

B. Play board games indoor.

C. Play shadow tag or swim in the pool.

....[1]

21. We can measure the air temperature using a _____.

A. Wind vane

B. Anemometer

C. Thermometer

....[1]

22. The following are the common living things can be found in the garden except for one.

A.

B.

C.

....[1]

23. What type of weather is in the picture below?

A. Sunny day B. Stormy day C. Rainy day

....[1]

LIVEWORKSHEETS