Measure capacity

1 4 glasses of water fill 1 jug.

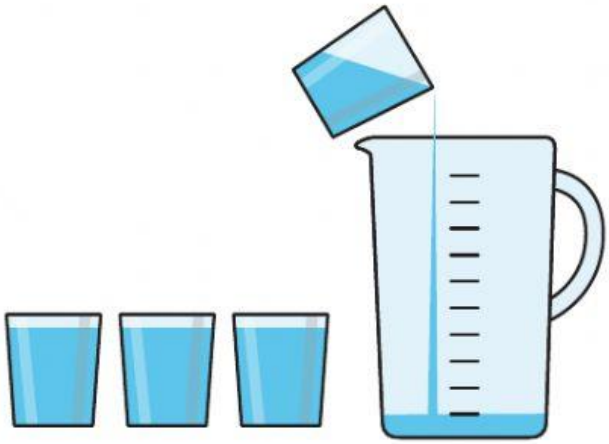

a) How many glasses will fill 2 jugs? ☐

b) Eva uses 20 glasses of water.



How many jugs can she fill?

Eva can fill ☐ jugs.

LIVEWORKSHEETS

2 Teddy pours these 6 glasses of juice.

He uses a whole bottle of juice.

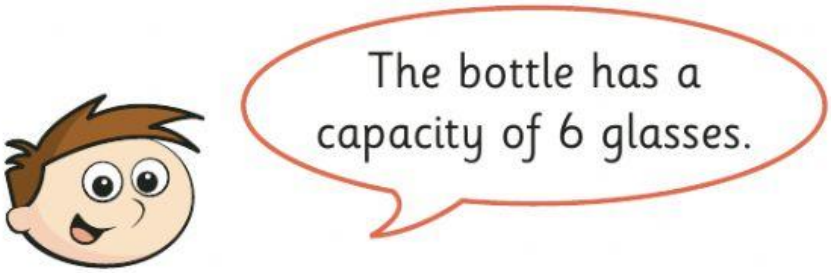

Do you agree with Teddy?_____

Talk about it with a partner.

3 It takes 8 glasses of water to fill a jug.



It takes 3 jugs of water to fill a bucket.



How many **glasses** of water fill a bucket?

What else can you find out?

© White Rose Maths 2019

LIVEWORKSHEETS