Phép trừ 4

1. *Nối.*

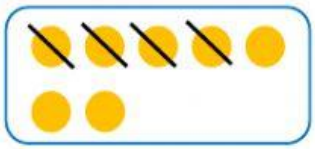

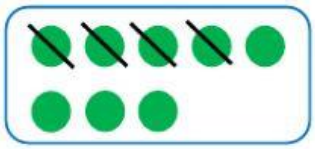



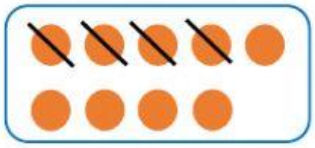

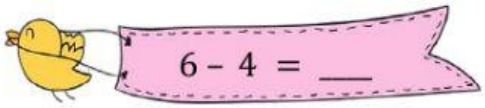

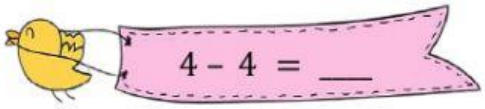

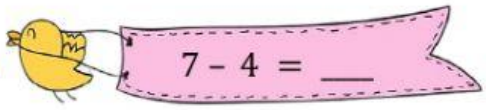

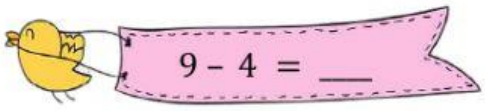

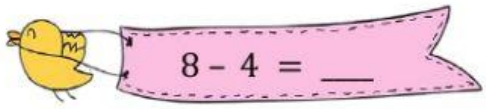

2.

đúng ---✓

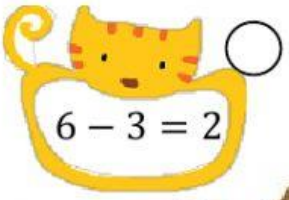

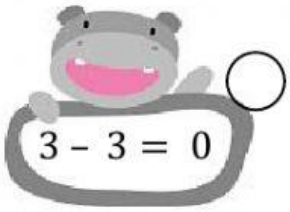



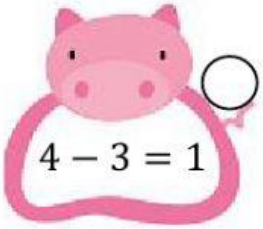

Tính.

3.

4 – 4 = ___

8 – 4 = ___

7 – 4 = ___

10 – 4 = ___

4.

5 – 4 = ___

6 – 4 = ___

9 – 4 = ___

LIVEWORKSHEETS

5. *Nối các phép tính có* ***cùng kết quả****.*

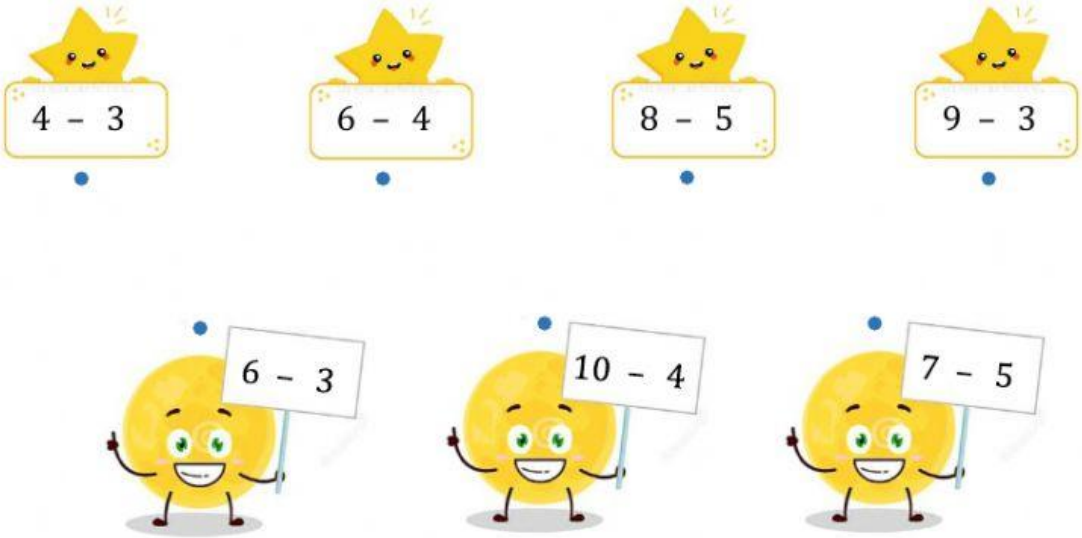

Điền dấu + hoặc −.

6.

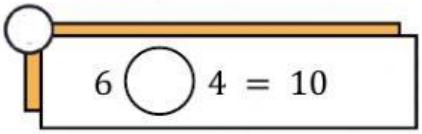

7.

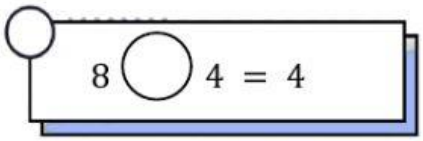

8. *Viết* ***phép tính*** *cho tranh vẽ.*

Có bao nhiêu con cua trong hang?

____ ◯ ____ = ____

LIVEWORKSHEETS