练习 2 简单机械和复杂机械

课本：页 170 – 180

A 填写简单机械的种类名称。 SP10.2.1 TP1

简单机械

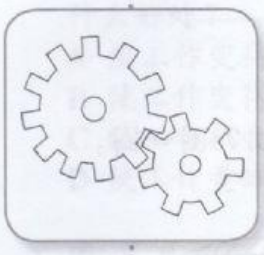

1. _____

2. _____

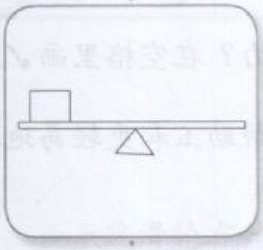

3. _____

4. _____

5. _____

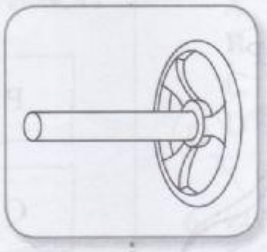

6. _____

7. _____

轮轴　滑轮　尖劈　螺旋　杠杆　斜面　齿轮

LIVEWORKSHEETS