Liceo República de Italia
Arturo Bonometti Brogi
Chillán

Resolución de Problemas

I Resuelve

1. Escribe el resultado de cada una de las divisiones. Usa los dibujos como ayuda

a) $8 \div 4 =$ _____

b) $12 \div 4 =$ _____



c) $15 \div 5 =$ _____

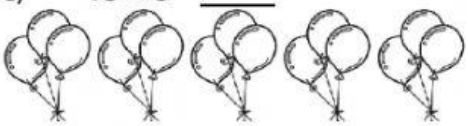

d) $20 \div 4 =$ _____



2. Escribe la división representada

a)

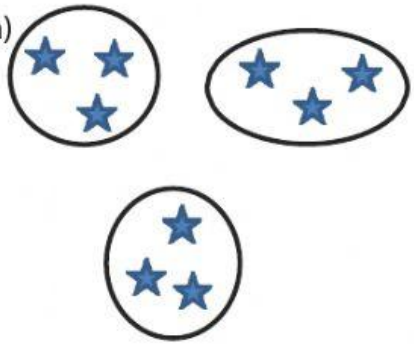

☐ : ☐ = ☐

b)

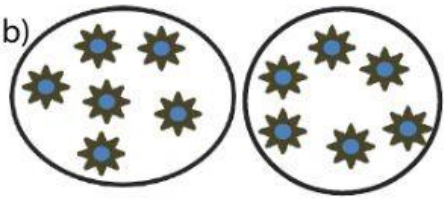

☐ : ☐ = ☐

LIVEWORKSHEETS