Tens and Ones

Write how many.

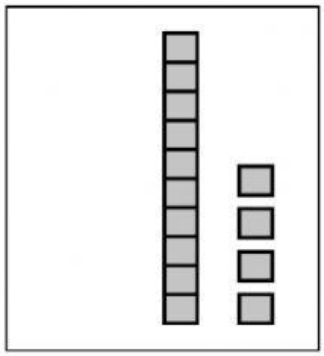

Tens	Ones

Number

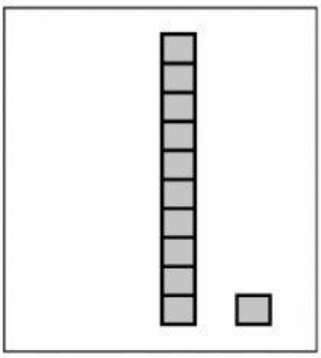

Tens	Ones

Number

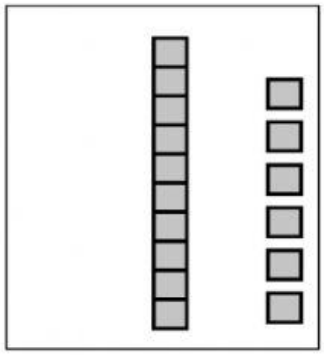

Tens	Ones

Number

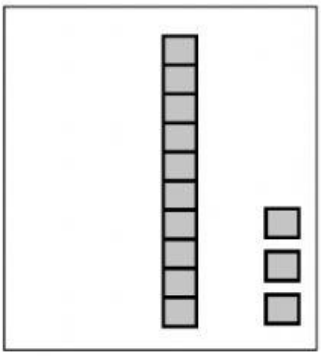

Tens	Ones

Number

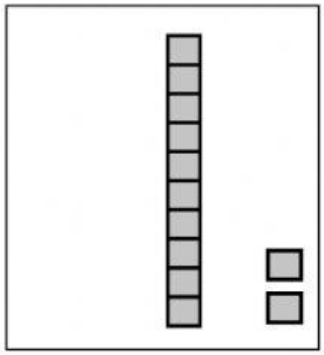

Tens	Ones

Number

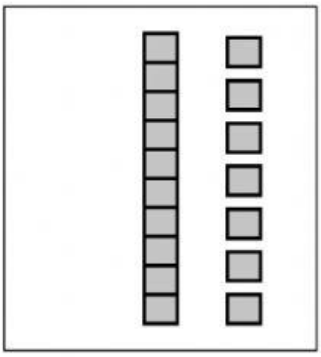

Tens	Ones

Number

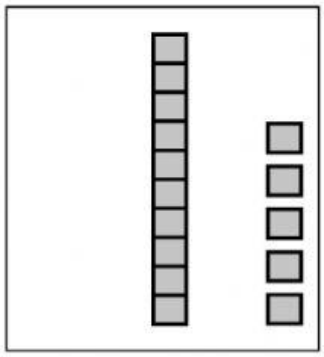

Tens	Ones

Number

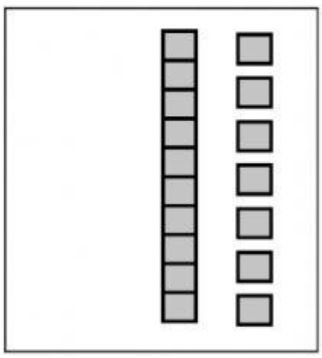

Tens	Ones

Number

LIVEWORKSHEETS

Ordering Numbers 1-20

Write the numbers in order from least to greatest.

17	8	13	—			
19	16	5	—			
14	9	12	—			
15	3	4	—			
16	5	11	—			
18	1	6	—			
20	2	12	—			
13	10	7	—			

LIVEWORKSHEETS

Comparing Numbers- Word Problems

1	Sally has 5 valentines. Sue has 10 valentines. How many more valentines does Sue have?	Sue has _____ more valentines than Sally.
2	Tim has 8 candies. Tommy has 3 candies. How many fewer candies does Tommy have?	Tommy has _____ fewer candies than Tim.
3	Sara has 10 hearts. Eric has 4 hearts. How many fewer hearts does Eric have?	Eric has _____ fewer hearts than Sara.
4	Alan has 7 chocolates. Molly has 6 chocolates. How many more chocolates does Alan have?	Alan has _____ more chocolates than Molly.
5	Amanda has 11 valentines. Rose has 6 valentines. How many fewer valentines does Rose have?	Rose has _____ fewer valentines than Amanda.

LIVEWORKSHEETS