NAMA :

Ulangkaji

Unit 2 Pecahan *Fractions*

Bidang Pembelajaran: Nombor dan Operasi

Kertas 1 Soalan Objektif

1 $9 - 2\frac{1}{3} =$

A $2\frac{1}{3}$

B $7\frac{2}{3}$

C $6\frac{2}{3}$

D 9

2 Rajah 1 terdiri daripada beberapa buah segi empat sama yang sama saiz.
Diagram 1 consists of several squares of equal size.



Rajah 1/Diagram 1

Antara berikut, yang manakah mewakili kawasan berlorek?
Which of the following represents the shaded region?

A $\frac{3}{10}$

B $\frac{3}{5}$

C $\frac{1}{5}$

D $\frac{3}{6}$

3 Rajah 2 terdiri daripada beberapa buah segi tiga yang sama besar.
Diagram 2 consists of several triangles of equal size.

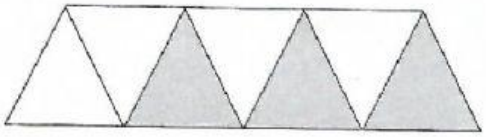

Rajah 2/Diagram 2

Antara pecahan berikut, yang manakah mewakili kawasan berlorek daripada seluruh rajah itu?
Which of the following fractions represents the coloured region of the whole diagram?

A $\frac{1}{3}$

B $\frac{3}{7}$

C $\frac{4}{9}$

D $\frac{3}{5}$

Praktis UPSR

4 Jadual 1 menunjukkan jisim gula di dalam empat buah paket.
Table 1 shows the mass of sugar in four packets.

Paket *Packet*	*P*	*Q*	*R*	*S*
Jisim gula *Mass of sugar*	4.5 kg	$4\frac{1}{2}$ kg	$4\frac{2}{5}$ kg	4.2 kg

Jadual 1/Table 1

Paket gula yang manakah mempunyai jisim yang sama?
Which packets of sugar have the same mass?

A *P* dan/*and Q*

B *P* dan/*and R*

C *Q* dan/*and S*

D *R* dan/*and S*

5 $\frac{2}{3} \div \frac{4}{5} =$

A $\frac{3}{4}$

B $\frac{3}{5}$

C $\frac{5}{6}$

D $\frac{8}{15}$

6 $14.5 \text{ kg} - \frac{3}{4} \text{ kg} - 560 \text{ g} =$

A 13 190 g

B 13 600 g

C 13 690 g

D 13 750 g

LIVEWORKSHEETS

Kertas 2 Soalan Subjektif

Praktis UPSR

1 Rajah 1 menunjukkan pecahan yang dibahagikan kepada beberapa bahagian yang sama besar.
Diagram 1 shows a circle divided into several parts of equal size.

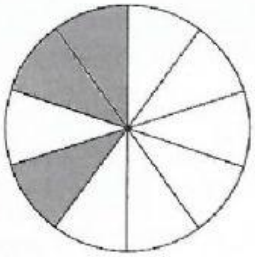

Rajah 1/Diagram 1

(a) Tulis pecahan yang mewakili bahagian berlorek daripada seluruh rajah.
Write a fraction that represents the shaded part of the whole diagram.

—

[1 *markah/mark*]

(b) Nyatakan nilai pecahan itu dalam nombor perpuluhan.
State the value of fraction in decimal number.

[1 *markah/mark*]

2 Rajah 2 menunjukkan dua buah bulatan yang dibahagikan kepada beberapa bahagian yang sama besar./*Diagram 2 shows two circles divided into several parts of equal size.*

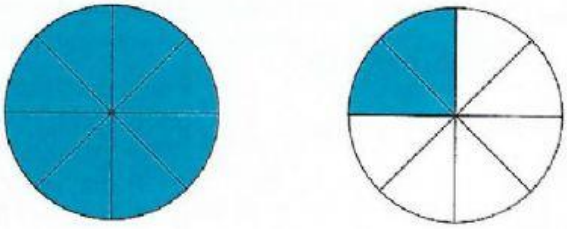

Rajah 2/Diagram 2

(a) Lorekkan $\frac{5}{4}$ daripada bulatan dalam Rajah 2.

Shade $\frac{5}{4}$ of the circles in Diagram 2.

$$\frac{5 \times __}{4 \times __} = _ = 1 _$$

[1 *markah/mark*]

(b) Berdasarkan jawapan di 2(a), nyatakan kawasan berlorek dalam nilai peratus.
Based on the answer in 2(a), state the shaded region in percentage.

$_ \times 100\%$

= _____ %

[2 *markah/marks*]

LIVEWORKSHEETS