HOMEWORK WEEK 10

NAME: **CLASS:**

3

Example

Copy and complete this operation diagram.
When you cross a line, follow the operation shown by the arrow.
When you cross a line in the opposite direction, reverse the operation.

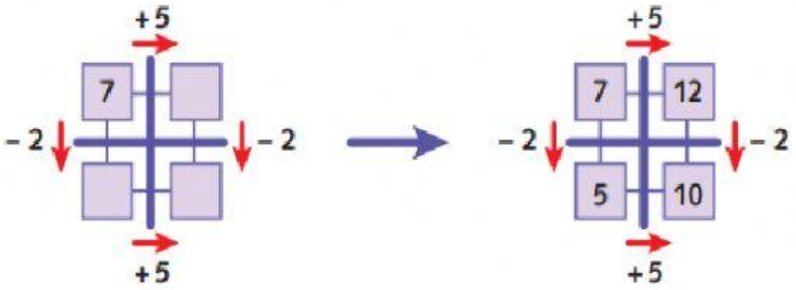

Copy and complete these operation diagrams in the same way.

a)

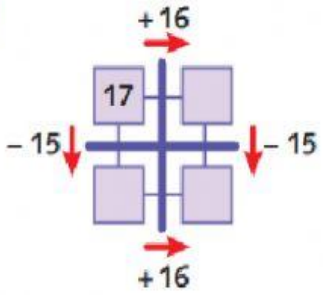

b)

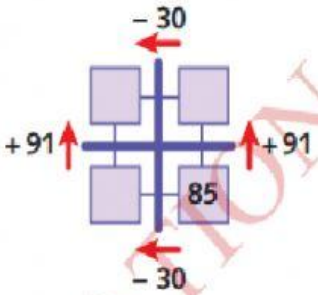

c)

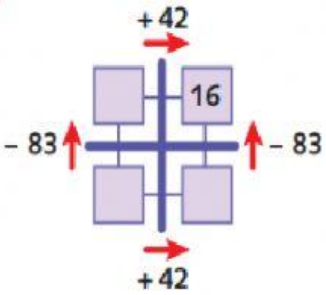

d)

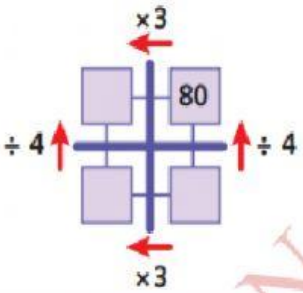

e)

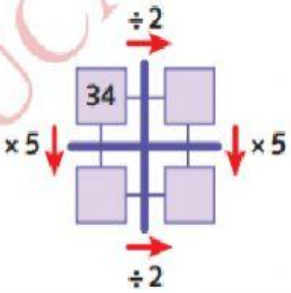

f)

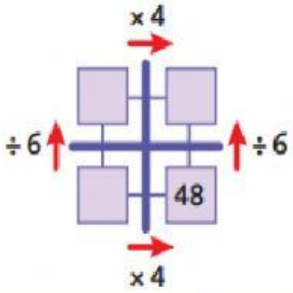

N EDUCATION CONFIDENTI

LIVEWORKSHEETS

HOMEWORK WEEK 10

NAME: **CLASS:**

5 Copy these statements. Use <, > or = to make each statement true.

a) $(4 \times 5) + (12 \div 4)$ ☐ $(8 + 6) + (3 \times 3)$

b) $24 - (8 \times 2) + 4$ ☐ $(4 \times 5) - (3 \times 4)$

c) $(4 \times 6) - (14 \div 7) + 8$ ☐ $6 \times (18 \div 3) - 4$

d) $(8 + 14) - (6 \times 3)$ ☐ $(6 + 9) \div (28 - 23)$

LIVEWORKSHEETS