Matching Story Problems to Decimal x Decimal Models

1. **Which model below would match the word story below?**

Dante had completed four tenths of his homework. Three tenths of that homework was math. What portion of the homework was math?

A

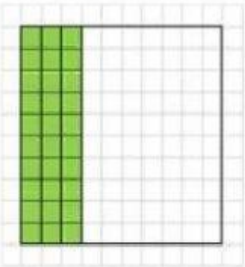

B

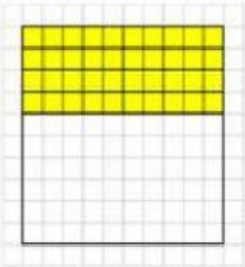

C

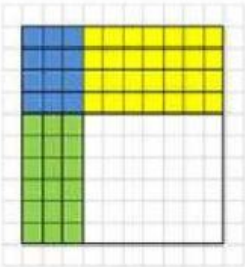

What decimal correctly answers the question above?

Which equation matches the story problem below?

Logan is going to run 0.5 of a mile. He has already run 0.1 of that distance. How far has he run?

A. 0.01 x 0.5 = 0.05 **B. 0.1 x 0.5 = 0.05** **C. 0.01 x 0.05 = 0.05**

Which model matches Logan's story?

A.

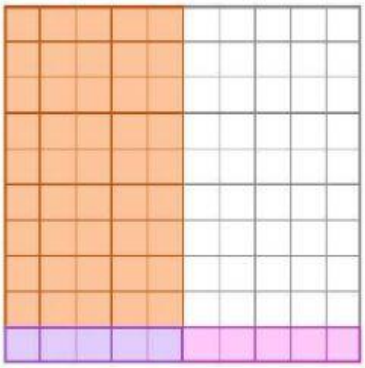

B.

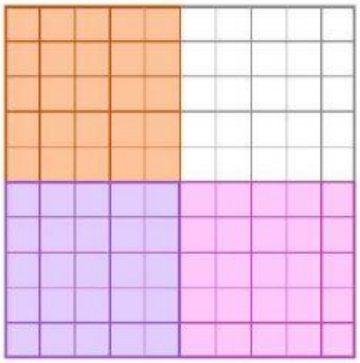

C.

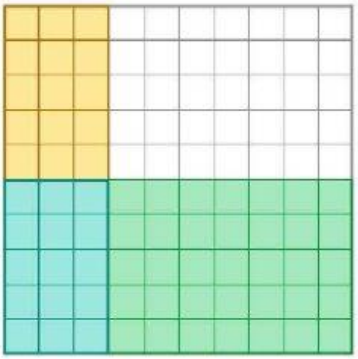

LIVEWORKSHEETS