KHỐI 5 TUỔI

BÉ ƠI! CÙNG HỌC NHÉ

Bé giỏi toán

Bé hãy đếm xem các nhóm đối tượng có số lượng bao nhiêu? Kéo số 6 thả nào nhóm có đối tượng tương ứng nhé !

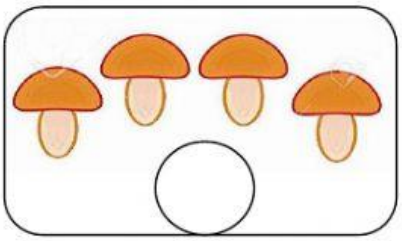

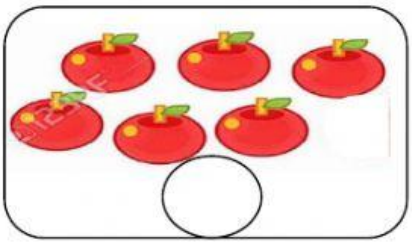



6 3 5 6 4

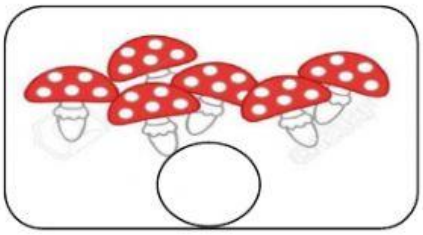

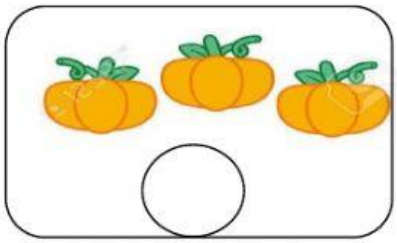

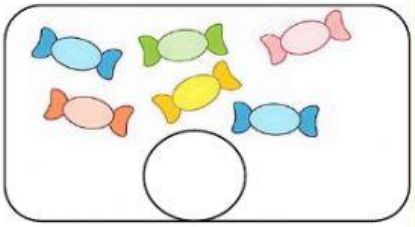

5 6 4 3 6



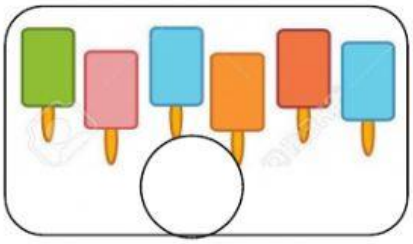



4 3 6 6 5

Các bé hãy nhấn vào link để cùng thực hiện bài tập nhé!

LIVEWORKSHEETS