Week 11 – Lesson 2

1) Martin has gone scuba diving. He has a list of sea creatures that he really wants to see. Can you give him the coordinates to find each of the sea creatures on his list?

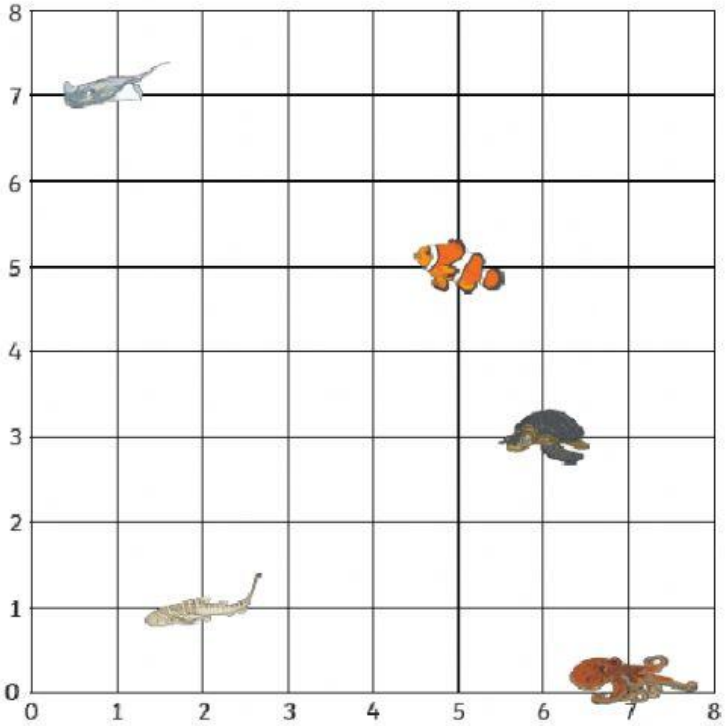

clownfish = (,)

zebra shark = (,)

stingray = (,)

octopus = (,)

turtle = (,)

LIVEWORKSHEETS

2) Sienna is studying a shipwreck. She needs to record what item she found at each location on the grid. Help her by drawing or writing the names of the shipwrecked items next to the correct coordinates.

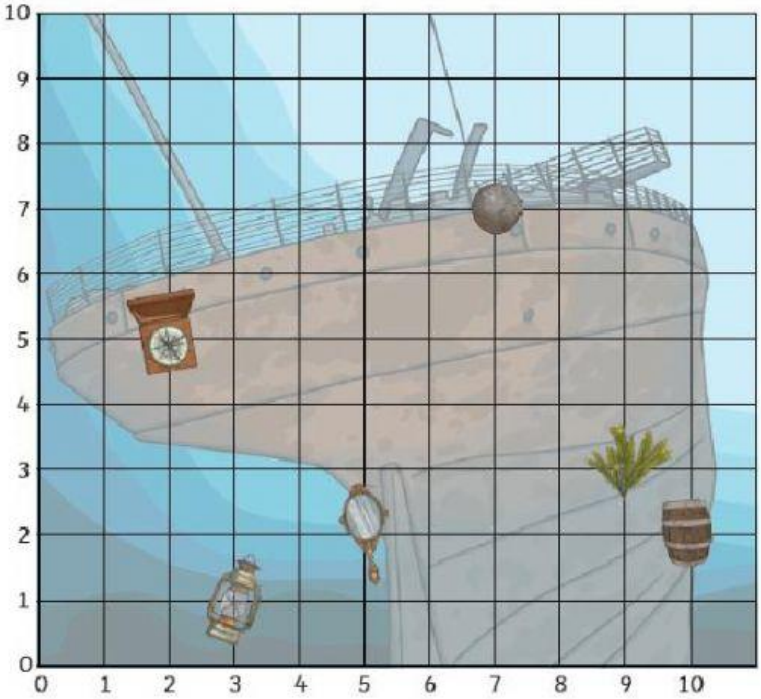

= (3,1)

= (2,5)

= (10,2)

= (9,3)

= (7,7)

= (5,2)

This shark is swimming in a straight line towards the boat. Two of the coordinates it will swim through are shown on the grid. Write the other coordinates the shark will swim through on its way to the boat.

LIVEWORKSHEETS

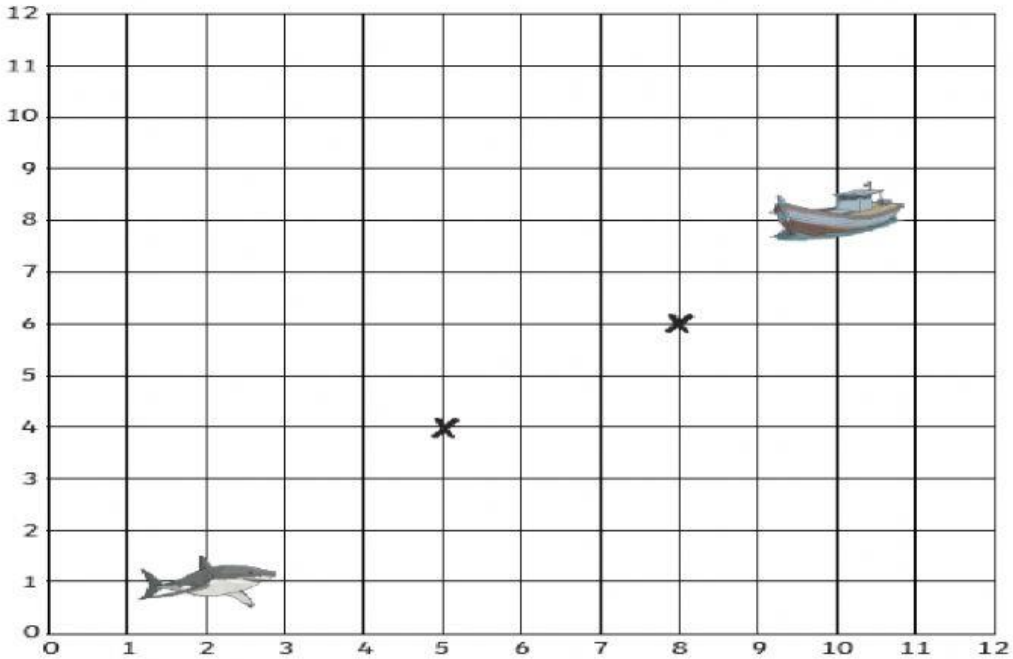

Co ordinates the shark will swim through:

LIVEWORKSHEETS