Mathematics Year 1

Unit 6: Length, Mass and Volume of Liquid

Name : _____

Class : _____

A. Solve the problems.

1. The pictures below show the mass of a papaya and a pineapple.



Compare the mass of the papaya and pineapple. Which one is heavier?

2. The length of is 6 .

The length of is 4 .

Which is longer, or ?

LIVEWORKSHEETS

3



Who is the tallest?
Who is the shortest?

The tallest :

The shortest :

4 Look at the pictures. What can you put into the pencil case?



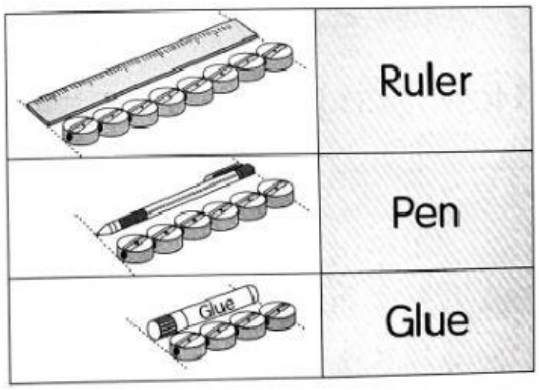

Tick your answer:		Ruler
		Pen
		Glue

LIVEWORKSHEETS

5



Look at the pictures above. Compare the mass of the jackfruit, pumpkin and watermelon. Determine the lightest and the heaviest fruit.

The lightest fruit :

The heaviest fruit :

6 Aminah pours into a few . Her sister drinks 2 . Her friends drink 4 .

How many glasses can fill?

is equal to .

LIVEWORKSHEETS

B. Complete the letters. What is Nabil's ambition?



a High sandcastle. ☐

b Long bench. ☐

c Short tree. ☐

d Heavy rock. ☐

e Light pail. ☐

f A bottle full of water. ☐

Nabil's ambition is to be a

☐☐☐☐☐☐

LIVEWORKSHEETS

C. Complete the sentences below.



a The length of is equal to ☐ .

b The length of is equal to ☐ .

c The length of is ☐ than the

d The volume of is ☐ than the .

e The volume of is ☐ than the .

f The mass of is equal to ☐ .

g The mass of is equal to ☐ .

h The mass of is ☐ than the .

LIVEWORKSHEETS