MATEMÁTICAS SECUENCIA 5

Actividad 1. Relaciona el llenado de cada recipiente con una de las gráficas.

a)

b) 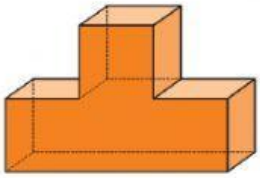

c) 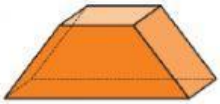

d)

e) 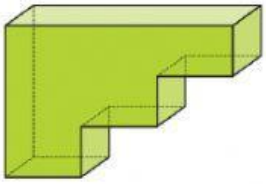

f) 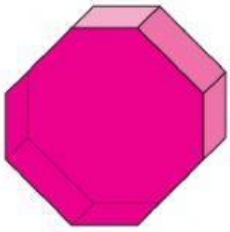

☐ 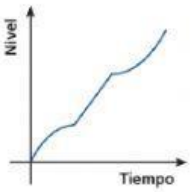

☐ 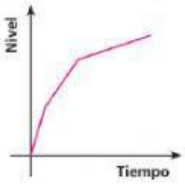

☐

☐ 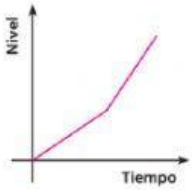

☐ 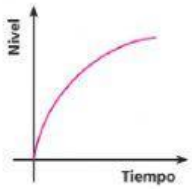

☐ 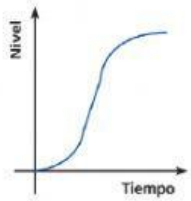

LIVEWORKSHEETS