PRE FIRST -MATEMÁTICAS

Actividades de apoyo .

Lee el nombre de las figuras y registra el número de vértices.

rectángulo



triángulo



círculo

hexágono



cuadrado



pentágono

Marca con una X el reloj que tiene ángulos rectos .

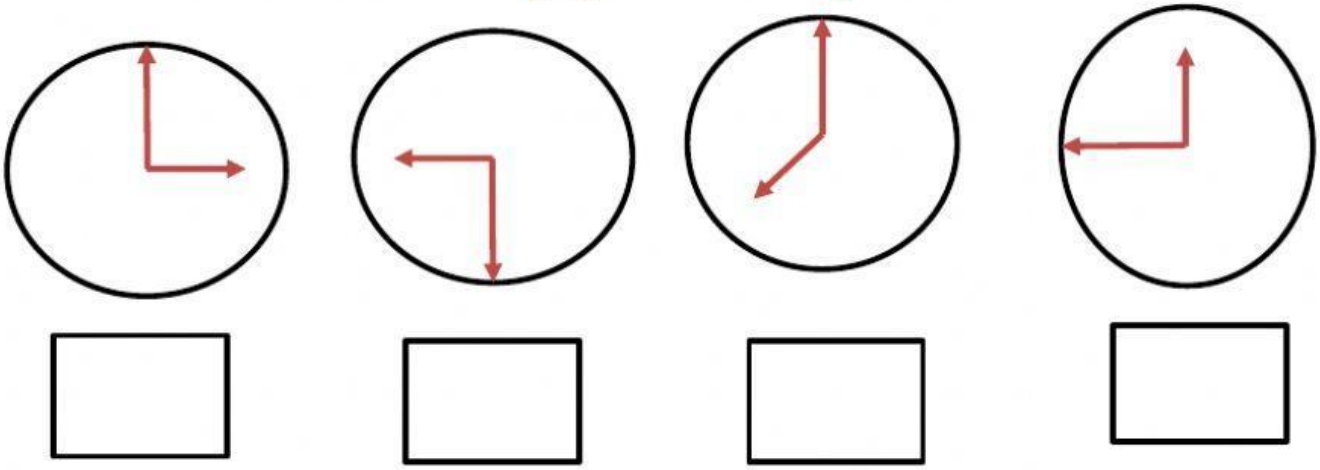

Resuelve las siguientes sumas.

22+3+2=	17+4+6=	37+2+4=
40+2+6=	22+5+1=	33+4+6=

LIVEWORKSHEETS