Pitagorina teorema

1. Koja od formula je ispravna za datu sliku?

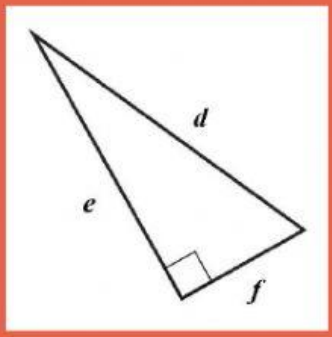

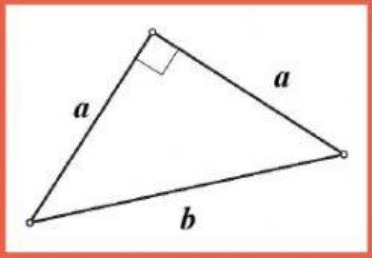

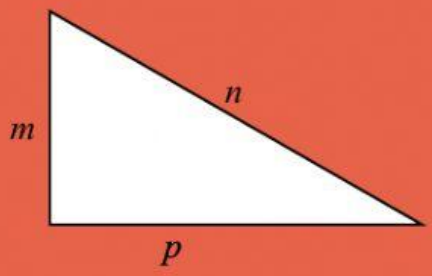

$d^2 + e^2 = f^2$
$d^2 + f^2 = e^2$
$f^2 + e^2 = d^2$
$e^2 + d^2 = f^2$

$a^2 + b^2 = a^2$
$2a^2 = b^2$
$4a^2 = b^2$

$m^2 + n^2 = p^2$
$p^2 + m^2 = n^2$
$n^2 + m^2 = p^2$
$p^2 + n^2 = m^2$

2. Kolika je površina nepoznatog kvadrata sa slike? Unesi broj.

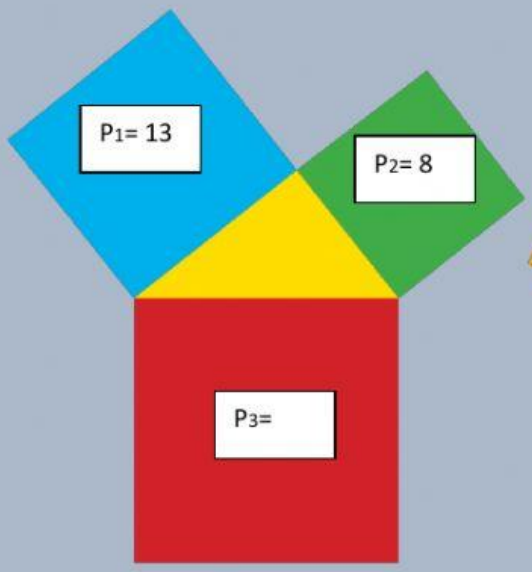

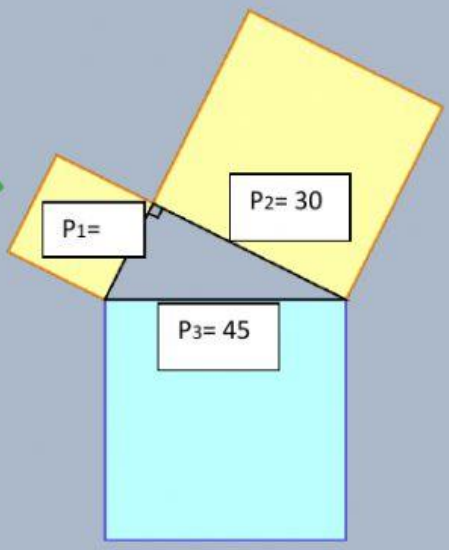

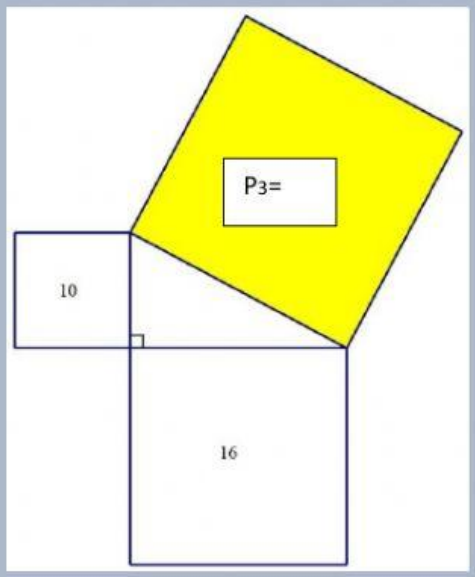

3. Koristeći Pitagorinu teoremu, nadopuni treću stranicu pravouglog trougla.

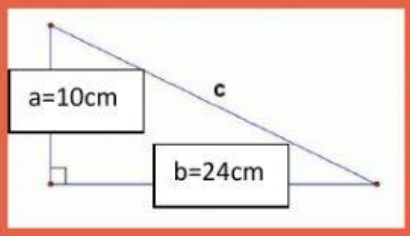

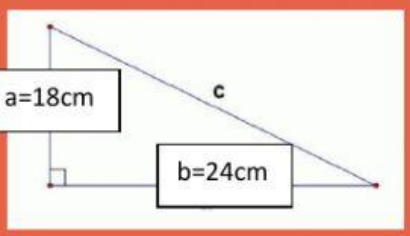

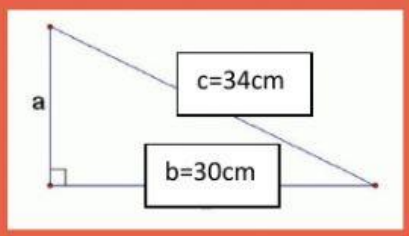

LIVEWORKSHEETS