CENTRO EDUCACIONAL KÍSSILA NEVES

Aluno(a): _____

Turma: 401 e 402 Data: _____/____/2021

Disciplina: Matemática Professora: _____

Atividade Complementar

1. Vamos comparar as frações? Pinte e depois marque a fração maior.

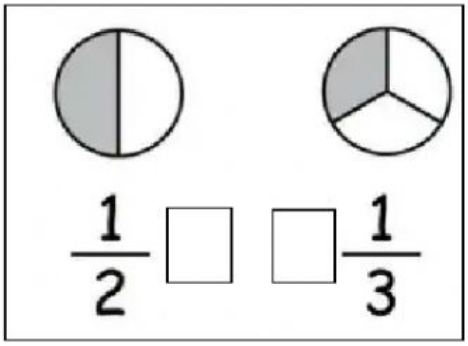

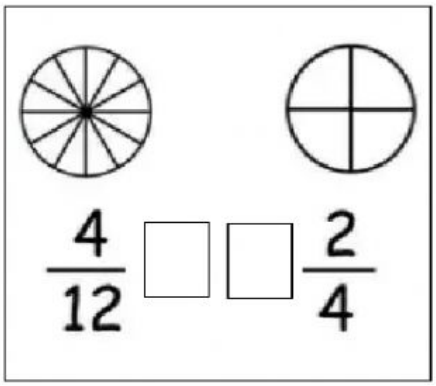

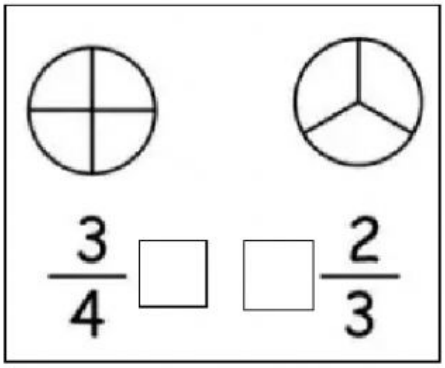

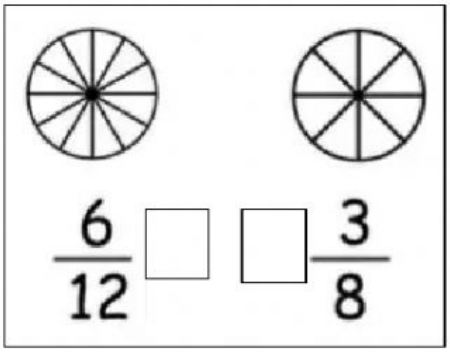

2. Observe as imagens, complete com as frações correspondentes e depois responda:

a)

_____

_____

Qual fração é maior? _____

b)

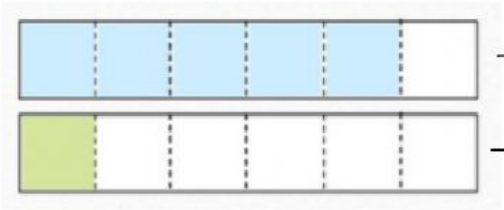

_____

_____

Qual fração é maior? _____

Já sei. ☺ Tenho que praticar. 😐 Ainda não sei. ☹

LIVEWORKSHEETS