Sudut Peluaran dan Sudut Pedalaman Poligon

HP: 2.2 (II)

Cari jumlah sudut pedalaman bagi setiap poligon di bawah.
(Katakan n = bilangan sisi sebuah poligon)
Find the sum of interior angles of each of the polygons below.
(Assume n = number of sides of a polygon)

1

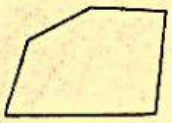

2

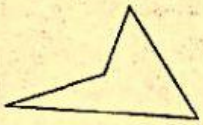

3

4



5

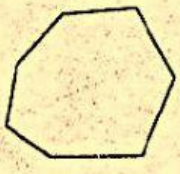

6

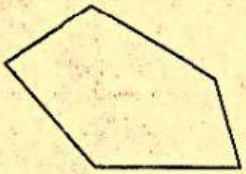

LIVEWORKSHEETS

2.2 Sudut Peluaran dan Sudut Pedalaman Poligon

HP: 2.2 (III)

Hitung nilai x dalam setiap poligon tak sekata yang berikut.
Calculate the value of x in each of the following irregular polygons.

1

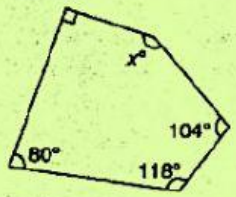

2

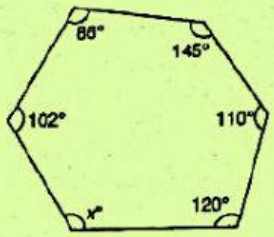

3

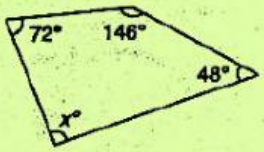

4

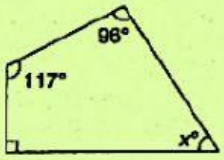

5

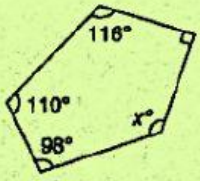

6

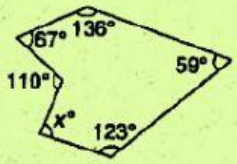

LIVEWORKSHEETS