KINGDOM OF BAHRAIN

NEW GENERATION PRIVATE SCHOOL

S.Y. 2021 – 2022

Mathematics Worksheet

Chapter 4: Area and Perimeter

Name:_____ **Class: Grade: 5**

Find the Perimeter of each shape:

1)

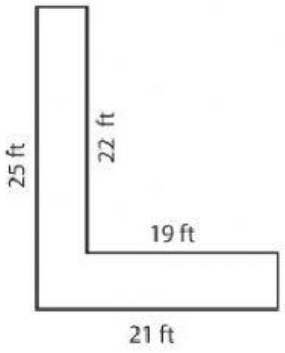

Perimeter = _____

2)

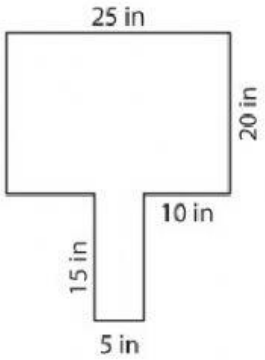

Perimeter = _____

3)

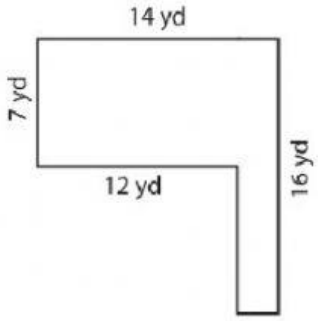

Perimeter = _____

4)

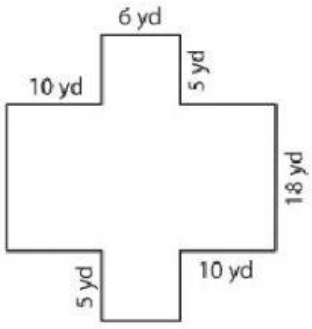

Perimeter = _____

5)

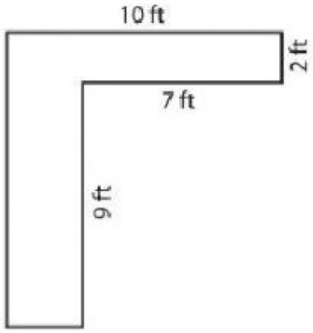

Perimeter = _____

6)

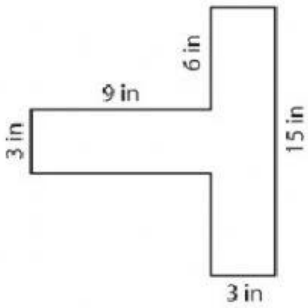

Perimeter = _____

LIVEWORKSHEETS