Measure mass

1 How much does each object weigh?

a)

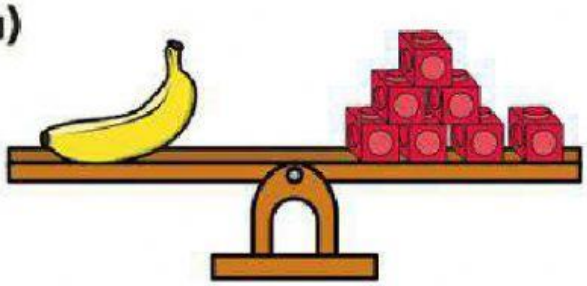

The banana weighs ☐ cubes.

b)

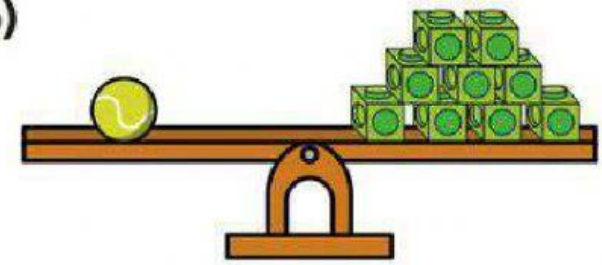

The tennis ball weighs ☐ cubes.

c)

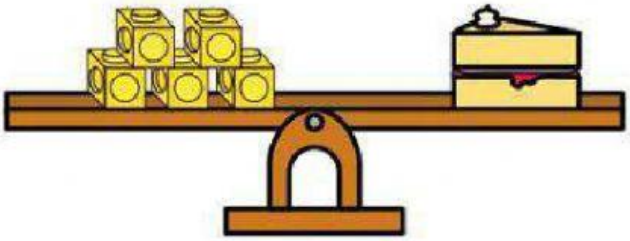

The slice of cake weighs ☐ cubes.

LIVEWORKSHEETS

Comparing the weight of objects: more than or less than

Maths worksheets from urbrainy.com

1.

The cake weighs _____ than the apples.



2.

The marbles weigh _____ than the orange.

3.

The cakes weighs _____ than the box.

Name:

© urbrainy.com
some images © Graphicfactory.com

LIVEWORKSHEETS

Fill in the missing gaps to make the sentences correct.

The _____ is heavier than the _____.

The _____ is lighter than the _____.

The _____ is equal to the _____.

LIVEWORKSHEETS

Measuring Mass Using Non-Standard Units Worksheet

1a. What is the **mass** of the frog?

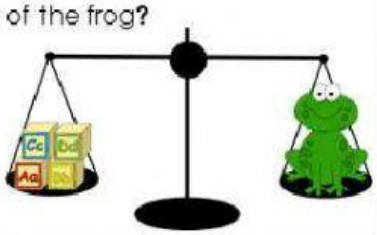

_____ blocks

1b. What would the scale look like if you took 2 blocks away?
Circle the correct scale.

2a. What is the **mass** of the mouse?

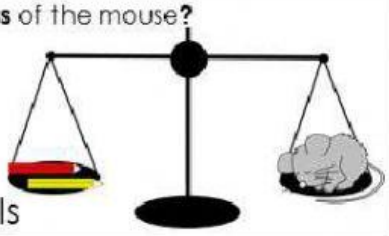

_____ pencils

2b. What would the scale look like if you added 2 pencils?
Circle the correct scale.



3a. What is the **mass** of the bird?

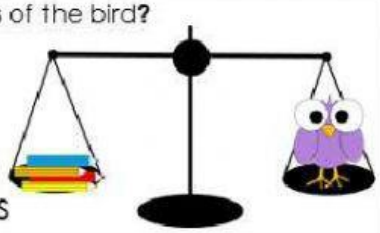

_____ pencils

3b. What would the scale look like if you took 1 pencil away?
Circle the correct scale.

4a. What is the **mass** of the snail?

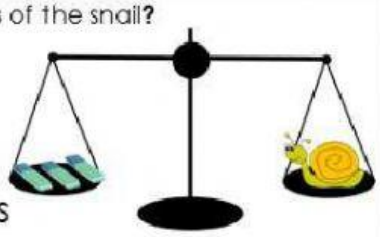

_____ erasers

4b. What would the scale look like if you added 2 erasers?
Circle the correct scale.

Copyright 2020 Online Teaching Resources Ltd

LIVEWORKSHEETS