Circumference of a circle

Find the circumference of each circle from the given radius or diameter =

Let pi π = 3.14

1.

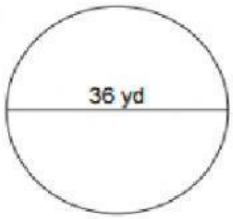

C = _____ yd

2.

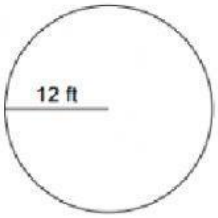

C = _____ ft

3.

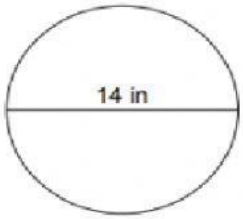

C = _____ in

4.

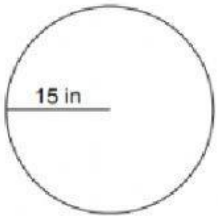

C = _____ in

5.

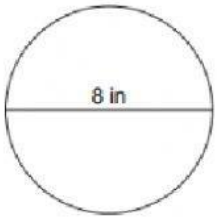

C = _____ in

6.

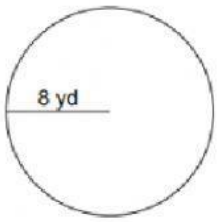

C = _____yd

(7) Given that the diameter of a circle is 42 cm. What is the circumference

Pi π $= \frac{22}{7}$

C = _____ =CM

LIVEWORKSHEETS

LIVEWORKSHEETS