COLEGIO LA ASUNCIÓN LEÓN

Nombre: N°

Fecha: 4to grado:

1. Convierte las siguientes fracciones de impropias a mixtas.

$\frac{13}{5} = ___$ $\frac{25}{9} = ___$

$\frac{17}{5} = ___$ $\frac{46}{9} = ___$

$\frac{38}{4} = ___$ $\frac{33}{4} = ___$

2. Convierte las siguientes fracciones de mixtas a impropias.

$5\frac{1}{7} = ___$ $7\frac{5}{2} = ___$

$4\frac{2}{3} = ___$ $3\frac{5}{8} = ___$

$2\frac{1}{6} = ___$ $3\frac{7}{13} = ___$

3. Observa cada gráfica, escribe la fracción correspondiente, selecciona si es propia, impropia o unitaria y escribe como se lee.



___

Se lee:

LIVEWORKSHEETS



Se lee:



Se lee:



Se lee:



Se lee:

LIVEWORKSHEETS