COLEGIO DE OCCIDENTE
UNIDAD TIJUANA URBANA
NIVEL PRIMARIA
OCTUBRE

MATHEMATICS

Name: _____ 2" B"

I. SELECT THE CORRECT GEOMETRIC FIGURE ACCORDING TO THE CHARACTERISTICS

1. Closed curve line

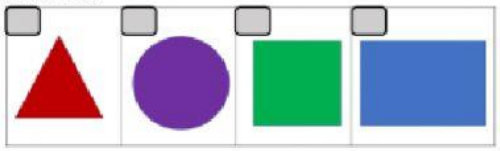

2. It has 2 equal short sides and 2 equal long sides



3. It has three equal sides:



4. It has four equal sides:



II. SOLVE THE FOLLOWING REASONING PROBLEM

A) There are 78 seats in a movie theater, if 46 are taken, how many are empty?

$$\begin{array}{r} 78 \\ -\ 46 \\ \hline \boxed{} \end{array}$$

III. COMPLETE THE NUMERICAL SERIES

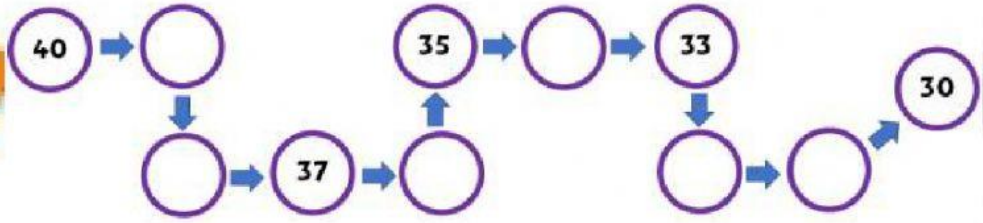

IV. WRITE IN THE CUBES THE NUMBER OF TENS AND UNITS THAT CORRESPONDS

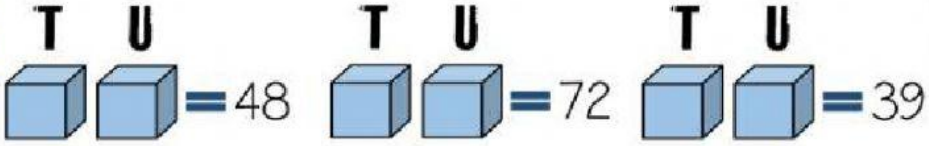

LIVEWORKSHEETS