Escuela Jorge Rosario Del Valle

I. Señala la fracción sombreada correspondiente a cada figura.

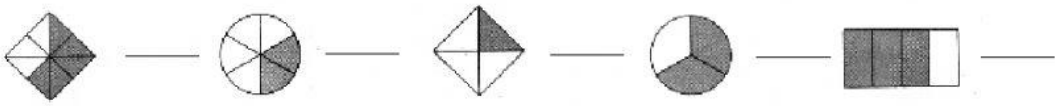

II. Sombrea la fracción indicada

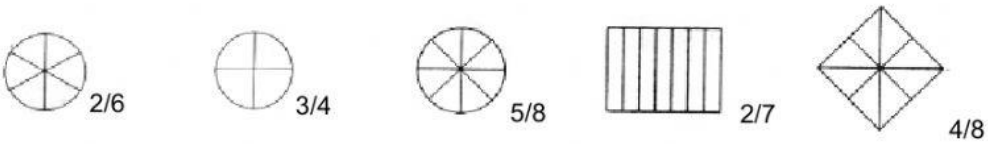

III. Escribe si es propia, impropia o mixta

$\frac{8}{5}$ _____ $\frac{2}{7}$ _____ $\frac{17}{6}$ _____ $2\frac{1}{12}$ _____

IV. Cambia cada fracción mixta a impropia

$2\frac{3}{5}$ = _____ $7\frac{1}{2}$ = _____ $1\frac{4}{9}$ = _____

V. Cambia de fracción impropia a fracción mixta

$\frac{17}{4}$ = _____ $\frac{23}{5}$ = _____ $\frac{9}{2}$ = _____

VI. Expresa como una fracción impropia y como número mixto.

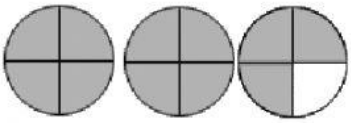

_____ = _____



_____ = _____

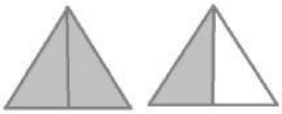

_____ = _____

LIVEWORKSHEETS