Tên:

Lớp:

PHIẾU TOÁN
SỐ 7

1. Nối hình với số tương ứng

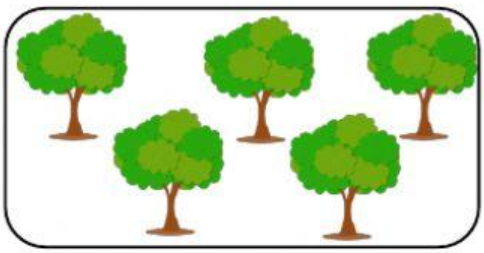

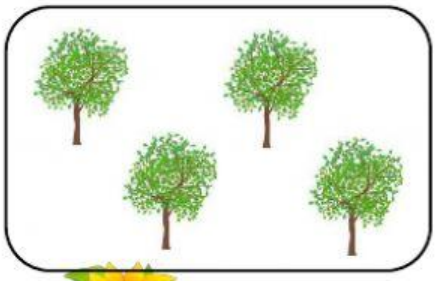



5

4

6

7

2. Số

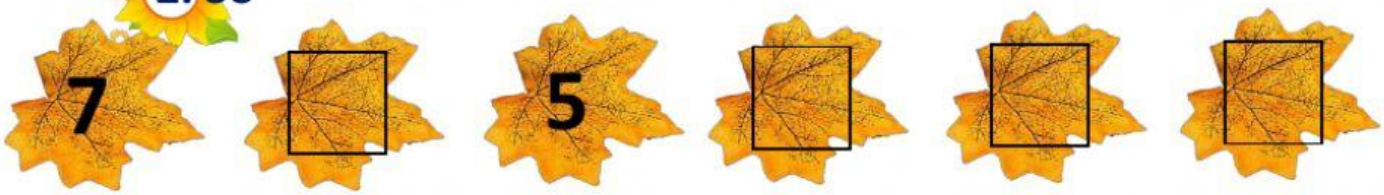



3. Làm cho bằng nhau (*thả hình vào các nhóm*)

LIVEWORKSHEETS

4.

> < =

2	4	7	6
5	5	3	7
7	3	1	6

5. Số

3 < ☐ < 5 7 > ☐ > 5 1 < ☐ < 3

6 > ☐ > 4 7 = ☐

6. Đánh dấu ✓ vào ô trả lời đúng

a) Bể nào có nhiều cá nhất?

b) Lọ nào cắm ít hoa nhất?

LIVEWORKSHEETS