Name: _____

Date: _____

A. Use the chart above to answer numbers 1 – 2.

1. Write the digit in the tenths place_____
2. Write the digit the hundredths place _____

B. Write the decimals in words. Choose your answer.

3. 0.4 = four tenths four tens
4. 0.07 = seven hundred seven hundredths

C. Choose the correct decimal to match each picture.

5.



a) 0.3
b) 0.4
c) 0.5

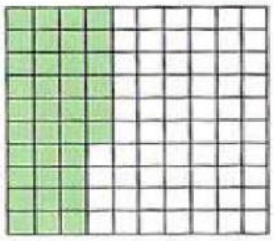

a) 0.36
b) 0.46
c) 0.56

LIVEWORKSHEETS

6.



a) 0.4

b) 0.5

c) 0.6



a) 0.60

b) 0.70

c) 0.80

7.

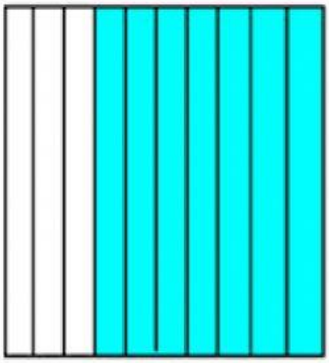

a) 0.3

b) 0.5

c) 0.7



a) 0.90

b) 0.70

c) 0.60

LIVEWORKSHEETS