GRADE 3 SUB MATH REEFA'A SCHOOL C-1 UNIT 3 LESSON 6 RELATE MULTIPLICATION & DIVISION

DATE: NAME:

I. Write the multiplication & division equation for given equal groups:

1. A. 4 groups of 5 = 20 B. 20 divided by 4 = 5

_____ × _____ = _____ _____ ÷ _____ = _____

II. Draw an array for the given equation:

1. 5 groups of 3 = 15

2. 8 divided by 4 = 2



III. Write the multiplication & division equation for the given array

a.



Activity: Multiplication Problems 1

Multiplication equation: _____ × _____ = _____

Division equation: _____ ÷ _____ = _____

LIVEWORKSHEETS

b.

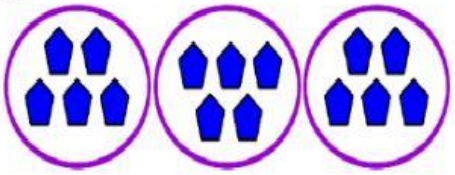

Multiplication equation: _____ × _____ = _____

Division equation: _____ ÷ _____ = _____

c.

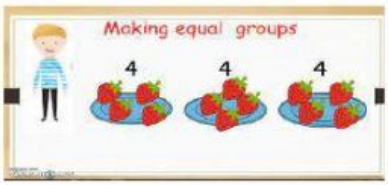

Multiplication equation: _____ × _____ = _____

Division equation: _____ ÷ _____ = _____

d.

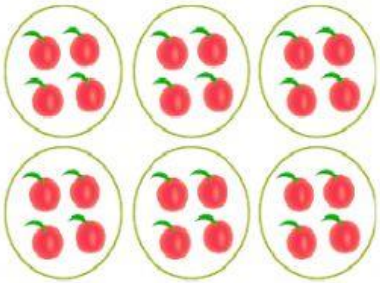

Multiplication equation: _____ × _____ = _____

Division equation: _____ ÷ _____ = _____

LIVEWORKSHEETS