姓名 ： _____ 一年级数学练习 日期: _____

单元二：基本运算

A)看图填一填

1.





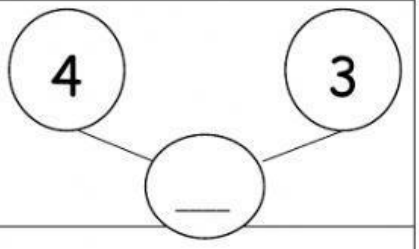

4 和 3 合起来是 _____。

2.

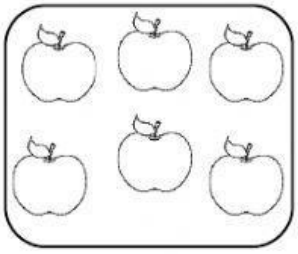



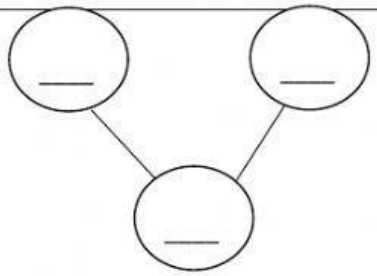

_____多 _____，一共是_____。

3.



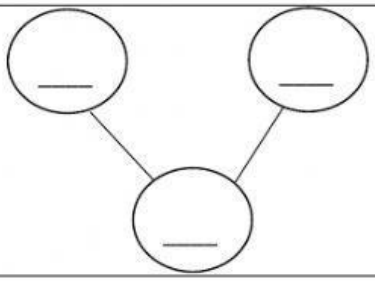

_____多 _____，等于_____。

4.



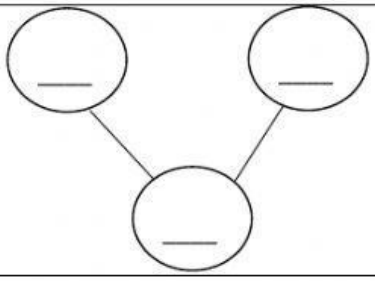

_____ 加 _____， 是 _____

LIVEWORKSHEETS

B）把组成中间的数目涂上颜色，然后写一写。

1.	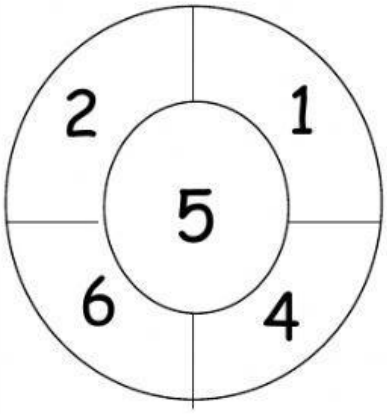	2.	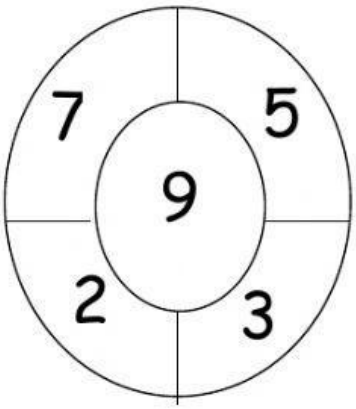	3.	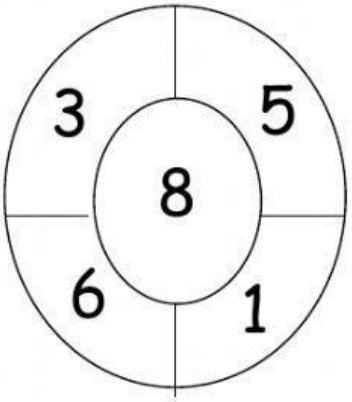
	_____加 _____等于_____		____和____合起来是 _____		_____加 _____等于_____
4.	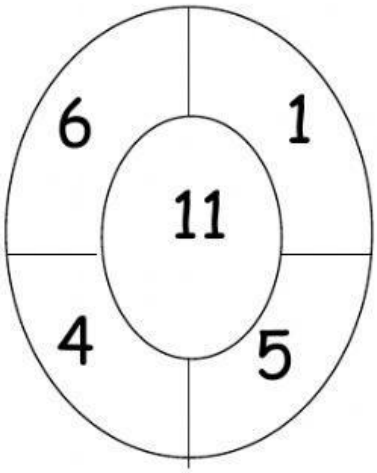	5.	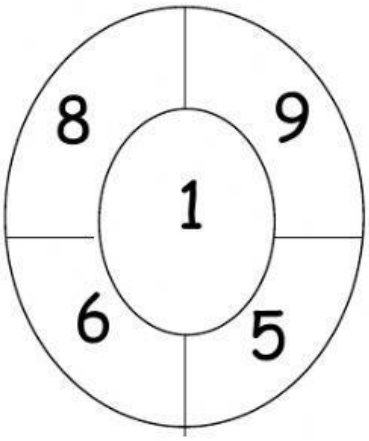	6.	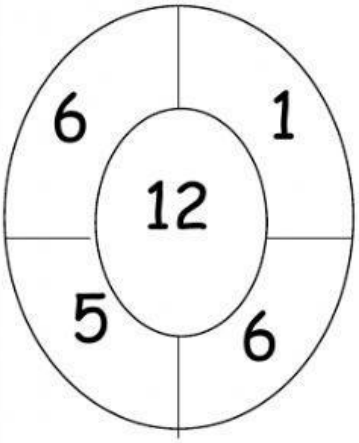
	____和____合起来是 _____		_____多 _____等于_____		_____加 _____等于_____

LIVEWORKSHEETS