Chapter 8 : Lines and Angles

Exercise 1 : Match the diagram of angles with the correct type of angle.

Diagram		Type of angle
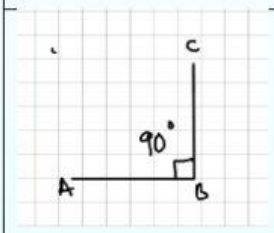		Acute angle
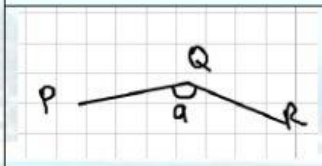		Angle on a straight line
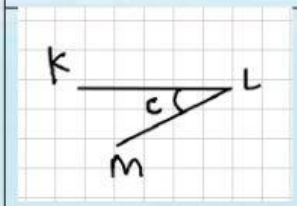		Obtuse angle
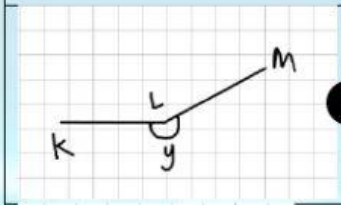		Reflex angle
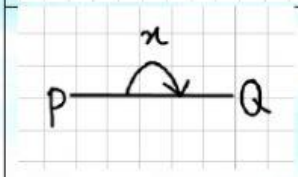		Right angle
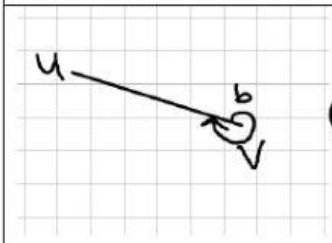		Whole turn angle

LIVEWORKSHEETS

Exercise 2 : State whether the statement is TRUE or FALSE

1- Reflex angle is in between 180^0 and 360^0. _____

2- Conjugate angle of 230^0 is 30^0. _____

3- If the sum of two angles that are side by side is 180^0, then, the angles are a pair of supplementary angles. _____

4- Sum of complementary angles is 90^0. _____

LIVEWORKSHEETS