Soalan 1

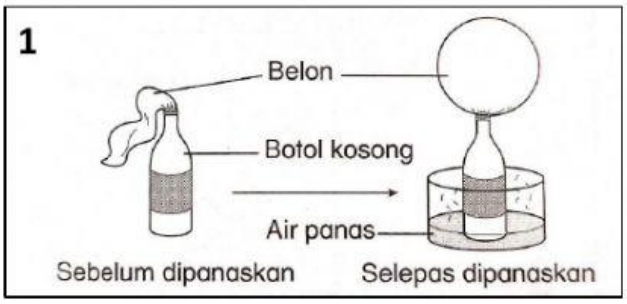

a) Pemerhatian :

Belon _____

b) Inferens :

_____dalam belon

_____ kerana _____

a) Pemerhatian :

Belon _____

b) Inferens :

_____ dalam belon

_____kerana _____

c) Kesimpulan :

Gas _____apabila _____dan _____ apabila _____

Soalan 2

1.

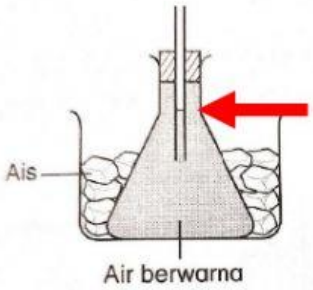

menurun | mengembang

meningkat | mengecut

Aras air bewarna _____ kerana air bewarna _____ apabila dipanaskan

2.

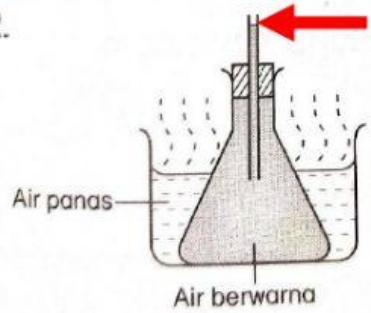

menurun | mengembang

meningkat | mengecut

Aras air bewarna _____ kerana air bewarna _____ apabila dipanaskan

LIVEWORKSHEETS