Name: _____ Date: _____ Grade: _____

GENERAL SCIENCE

UNIT: LABORATORY INSTRUMENTS & SAFETY

INSTRUCTIONS: Choose the correct answer by circling the letter a, b, c or d. Each question in this section is worth 1 point.

1. Which instrument is used to measure the volume of a liquid?
a. Beam balance
b. Flask
c. Beaker
d. Measuring cylinder

2. Which apparatus measures the mass of an object?
a. Balance
b. Stopwatch
c. Measuring cylinder
d. Thermometer

3. Which piece of laboratory equipment makes use of air pressure?
a. Beaker
b. Forceps
c. Measuring cylinder
d. Medicine dropper

4. What part of the microscope directs light unto the object?
a. Eyepiece
b. Lens
c. Mirror
d. Stage

LIVEWORKSHEETS

5. Which is a rectangular piece of glass attached to the stage of a microscope?

a. Eyepiece
b. Lens
c. Slide
d. Mirror

6.The diagram shows pieces of scientific apparatuses. Name the apparatuses labelled 1-10.

1.

_____

2.

_____

3.

_____

4.

_____

5.

_____

6.

_____

7.

_____

8.

_____

9.
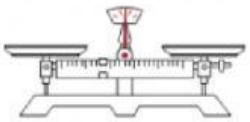
_____

10
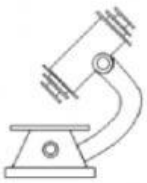
_____

LIVEWORKSHEETS

7.While working in a lab setting, students must take precaution by wearing protective gear. List three protective gears that is worn in the lab. (3pt)

1. _____

2. _____

3. _____

8. The image below demonstrates students that are breaking lab regulations. Provide **SIX i**nfractions that you see from the image below.



LIVEWORKSHEETS

1. _____

2. _____

3. _____

4. _____

5. _____

6. _____

TOTAL: _____/24

LIVEWORKSHEETS