AREA OF COMPOSITE FIGURES

Fill in the blanks WITH NUMBERS ONLY

Find the area of each composite figures. (HINT: separate the shapes first, and then find the area one by one)

Remember → A = L x B

1.

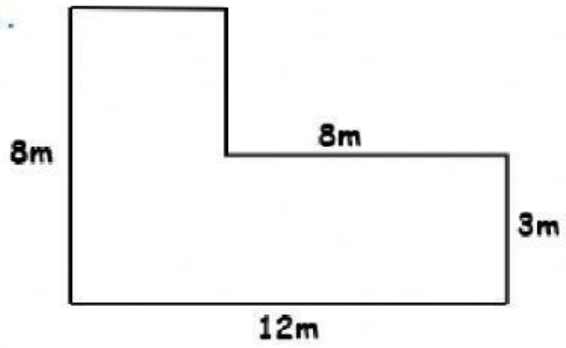

(Hint: split into 2 rectangles first, and then find area of each rectangle one by one)

Area of rectangle A = _____ m^2

Area of rectangle B = _____ m^2

Total area (A+B) = _____ m^2

2.

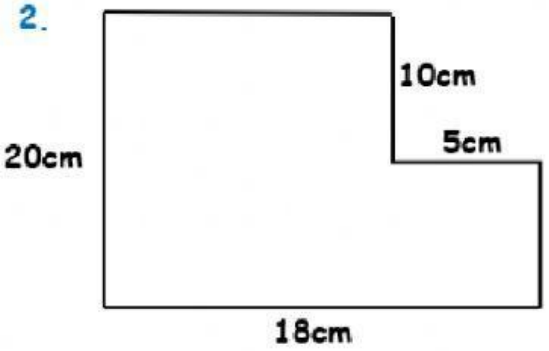

(Hint: split into 2 rectangles first, and then find area of each rectangle one by one)

Area of rectangle A = _____ cm^2

Area of rectangle B = _____ cm^2

Total area (A+B) = _____ cm^2

3.

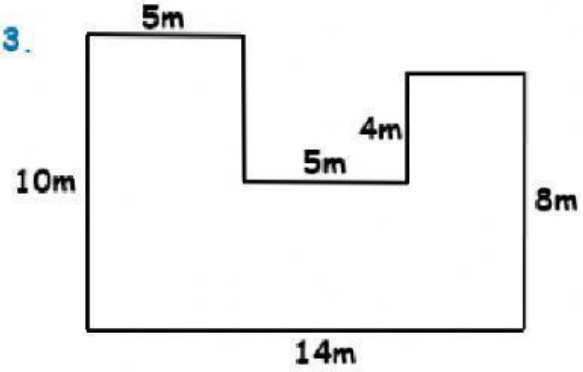

(Hint: split into 3 rectangles first, and then find area of each rectangle one by one)

Area of rectangle A = _____ m^2

Area of rectangle B = _____ m^2

Area of rectangle C = _____ m^2

Total area (A+B+C) = _____ m^2

LIVEWORKSHEETS