Name : _____ Date : _____

Mathematics

Find the area of the following triangle. Remember to use the correct formula.

1)

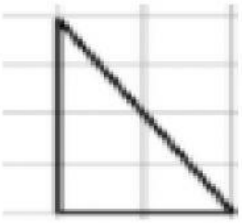

Area of triangle = $\frac{b \times h}{2}$

_____ = cm²

2)

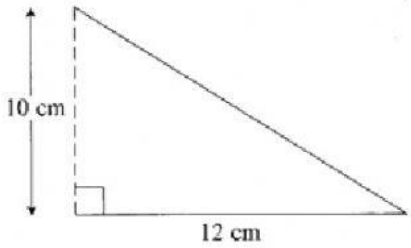

= _____

_____ = cm²

3)

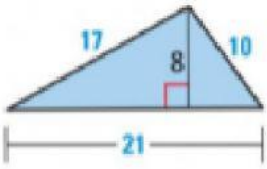

= _____

_____ = cm²

4)

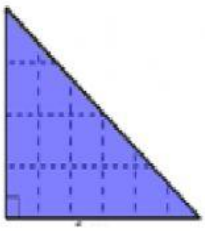

= _____

_____ = cm²

6

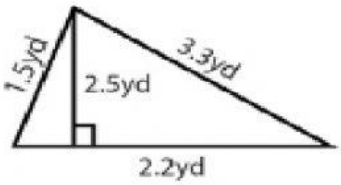

= _____

_____ = yd²

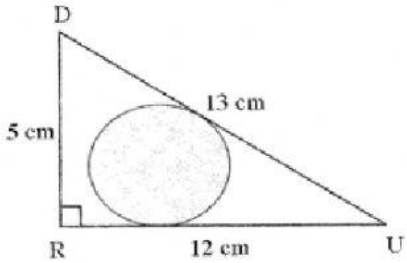

= _____

_____ = cm2

LIVEWORKSHEETS