COLEGIO BILINGÜE CEDAM

Geometry 6th grade

LIVEWORKSHEETS

1

Find the area of this triangle (in cm²):

a=12cm

h=7cm

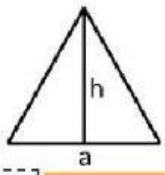

Your answer: _____ cm²

2

Find the area of this triangle (in cm²):

a=10cm

h=5cm

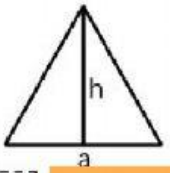

Your answer: _____ cm²

LIVEWORKSHEETS

3.

Find the area of this triangle (in cm^2):

a=10cm

h=12cm

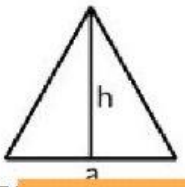

Your answer: _____ cm^2

4.

Find the area of this triangle (in cm^2):

a=5cm

h=8cm

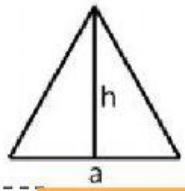

Your answer: _____ cm^2

LIVEWORKSHEETS

Find the area of this triangle (in cm^2):

a=6cm

h=4cm

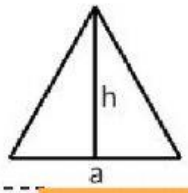

Your answer: _____ cm^2

Find the area of this triangle (in cm^2):

a=7cm

h=7cm

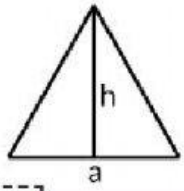

Your answer: _____ cm^2

Find the area of this triangle (in cm^2):

a=1cm

h=7cm

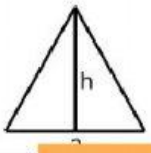

Your answer: _____ cm^2

LIVEWORKSHEETS

Find the area of this square (in cm^2):

a=5cm

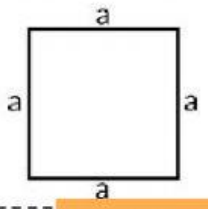

Your answer: _____ cm^2

Find the area of this square (in cm^2):

a=10cm

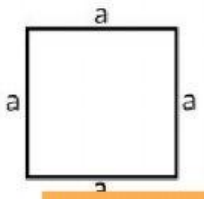

Your answer: _____ cm^2

LIVEWORKSHEETS

Find the area of this square (in cm²):

a=6cm

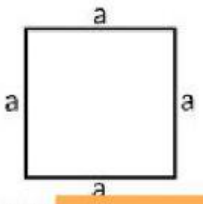

Your answer: _____ cm²

Find the area of this rectangle (in cm²):

a=5cm

b=2cm

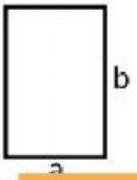

Your answer: _____ cm²

LIVEWORKSHEETS

Find the area of this rectangle (in cm^2):

a=4cm

b=6cm

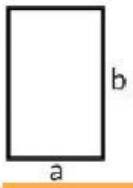

Your answer: _____ cm^2

Find the area of this rectangle (in cm^2):

a=12cm

b=6cm



Your answer: _____ cm^2

LIVEWORKSHEETS

Know : radius
What is its Area?

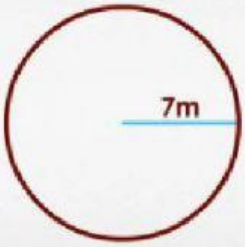

m^2

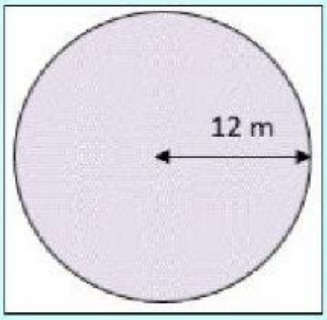

m^2

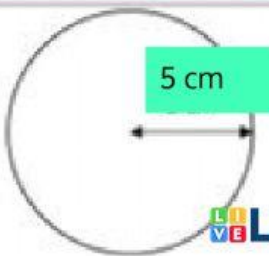

cm^2

LIVEWORKSHEETS