NOME:

DATA: TURMA:

SOMANDO COM BRINQUEDOS

CONTE E ESCREVA A QUANTIDADE DE CADA GRUPO E RESOLVA AS ADIÇÕES:

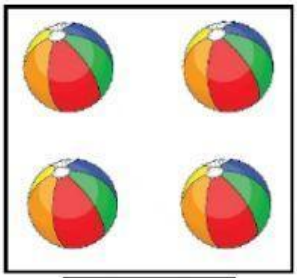

+

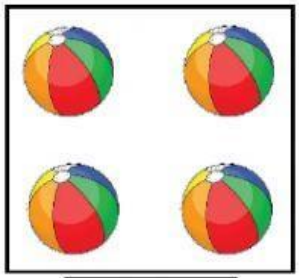

=



+



=



+



=

Analice Gomes

LIVEWORKSHEETS