DELHI PUBLIC SCHOOL NEWTOWN
SESSION 2021-2022
MATHEMATICS WORKSHEET
3D – SHAPES

CLASS- I **SEC -_____**
NAME - _____ **DATE- _____**

I. Match each name to the picture that best represents it.

- cone
- cube
- sphere
- cylinder
- cuboid

LIVEWORKSHEETS

DELHI PUBLIC SCHOOL NEWTOWN
SESSION 2021-2022
MATHEMATICS WORKSHEET
3D - SHAPES

CLASS- I **SEC -_____**
NAME - _____ **DATE- _____**

SOLID SHAPES



CUBE

Faces_____

Edges_____

Vertices_____

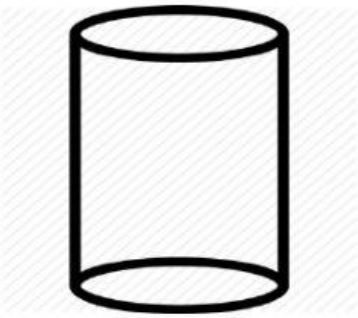

CYLINDER

Flat faces_____

Curved face ____

Vertices _____

Edges _____



CONE

Flat faces_____

Curved face _____

Vertex _____

Edge _____

SPHERE

Curved face_____

Edges_____

Vertices_____



CUBOID

Faces _____

Edges _____

Vertices _____

LIVEWORKSHEETS

DELHI PUBLIC SCHOOL NEWTOWN
SESSION 2021-2022
MATHEMATICS WORKSHEET
2D - SHAPES

CLASS- I **SEC -_____**
NAME - _____ **DATE- _____**

2D SHAPES



CIRCLE

Sides _____

Vertices_____

SQUARE

Sides _____

Vertices _____

RECTANGLE

Sides _____

Vertices _____

TRIANGLE

Sides _____

Vertices_____



OVAL

Sides _____

Vertices _____

LIVEWORKSHEETS

DELHI PUBLIC SCHOOL NEWTOWN
SESSION 2021-2022
MATHEMATICS WORKSHEET
2D SHAPES

CLASS- I **SEC - _____**
NAME - _____ **DATE- _____**

WHICH 2D SHAPE AM I?

I have four sides and four corners. All my sides are of equal length.

I have three sides and three corners.

I am round and curvy. I have no sides and no corners.

I have four sides and four corners. My opposite sides are of equal length.

I am the shape of an egg. I have no corners.

oval **square** **triangle** **circle** **rectangle**

LIVEWORKSHEETS